Subtracting from a Two-Digit Number · 1

$64 - 2 = ___$

Subtracting from a Two-Digit Number · 2

$73 - 60 = ___$

Subtracting from a Two-Digit Number · 3

$89 - ___ = 81$

Subtracting from a Two-Digit Number · 4

$42 - 40 = ___$

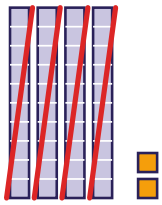

Subtracting from a Two-Digit Number · 5

7 ones − 7 ones = 0 ones.

The 9 tens stay. 97 − 7 = ___

Subtracting from a Two-Digit Number · 6

Subtract.

$$\begin{array}{r} 85 \\ ?\ 80 \\ \hline \end{array}$$

Subtracting from a Two-Digit Number · 7

Ava has 44 buttons and gives away 4. How many buttons does Ava have left?

Subtracting from a Two-Digit Number · 8

$57 - ___ = 7$

Subtracting from a Two-Digit Number · 2

ANSWER

13

Subtracting from a Two-Digit Number · 1

ANSWER

62

Subtracting from a Two-Digit Number · 4

ANSWER

2

Subtracting from a Two-Digit Number · 3

ANSWER

8

Subtracting from a Two-Digit Number · 6

ANSWER

5

Subtracting from a Two-Digit Number · 5

ANSWER

90

Subtracting from a Two-Digit Number · 8

ANSWER

50

Subtracting from a Two-Digit Number · 7

ANSWER

40

Subtracting from a Two-Digit Number · 9

$78 - 5 = ___$

Subtracting from a Two-Digit Number · 10

$95 - 70 = ___$

Subtracting from a Two-Digit Number · 11

$68 - ___ = 62$

Subtracting from a Two-Digit Number · 12

$88 - 20 = ___$

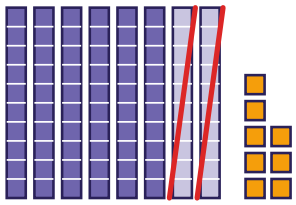

Subtracting from a Two-Digit Number · 13

4 ones − 3 ones = 1 one. The 4 tens stay. 44 − 3 = ___

Subtracting from a Two-Digit Number · 14

Subtract.

$$\begin{array}{r} 79 \\ -\ 60 \\ \hline \end{array}$$

Subtracting from a Two-Digit Number · 15

Mia has 44 crayons and gives away 4. How many crayons does Mia have left?

Subtracting from a Two-Digit Number · 16

$42 - ___ = 2$

Subtracting from a Two-Digit Number · 10

ANSWER

25

Subtracting from a Two-Digit Number · 9

ANSWER

73

Subtracting from a Two-Digit Number · 12

ANSWER

68

Subtracting from a Two-Digit Number · 11

ANSWER

6

Subtracting from a Two-Digit Number · 14

ANSWER

19

Subtracting from a Two-Digit Number · 13

ANSWER

41

Subtracting from a Two-Digit Number · 16

ANSWER

40

Subtracting from a Two-Digit Number · 15

ANSWER

40

Subtracting from a Two-Digit Number · 17

$68 - 2 = ___$

Subtracting from a Two-Digit Number · 18

$36 - 30 = ___$

Subtracting from a Two-Digit Number · 19

$65 - ___ = 61$

Subtracting from a Two-Digit Number · 20

$72 - 30 = ___$

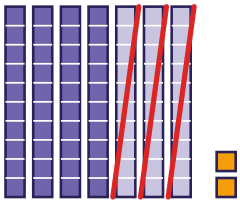

Subtracting from a Two-Digit Number · 21

3 ones − 3 ones = 0 ones.

The 3 tens stay. 33 − 3 = ___

Subtracting from a Two-Digit Number · 22

Subtract.

$$\begin{array}{r} 45 \\ ?\ 40 \\ \hline \end{array}$$

Subtracting from a Two-Digit Number · 23

Max has 46 cards and gives away 5. How many cards does Max have left?

Subtracting from a Two-Digit Number · 24

$83 - ___ = 53$

Subtracting from a Two-Digit Number · 18

ANSWER

6

Subtracting from a Two-Digit Number · 17

ANSWER

66

Subtracting from a Two-Digit Number · 20

ANSWER

42

Subtracting from a Two-Digit Number · 19

ANSWER

4

Subtracting from a Two-Digit Number · 22

ANSWER

5

Subtracting from a Two-Digit Number · 21

ANSWER

30

Subtracting from a Two-Digit Number · 24

ANSWER

30

Subtracting from a Two-Digit Number · 23

ANSWER

41