Subtracting from a Two-Digit Number · 1

$38 - 5 = ___$

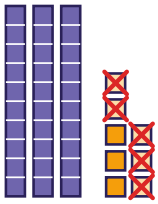

Subtracting from a Two-Digit Number · 2

$18 - 6 = ___$

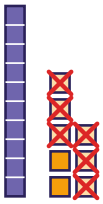

Subtracting from a Two-Digit Number · 3

$32 - 2 = ___$

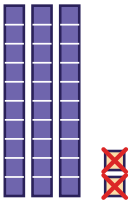

Subtracting from a Two-Digit Number · 4

The blocks show 17. 3 ones are crossed out. How many are left?

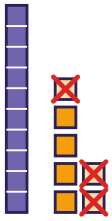

Subtracting from a Two-Digit Number · 5

7 ones − 1 one = 6 ones. The 2 tens stay.

$27 - 1 = ___$

Subtracting from a Two-Digit Number · 6

Subtract.

$$\begin{array}{r} 38 \\ -\ 3 \\ \hline \end{array}$$

Subtracting from a Two-Digit Number · 7

Leo has 39 stickers and gives away 3. How many stickers does Leo have left?

Subtracting from a Two-Digit Number · 8

$12 - 2 = ___$

Subtracting from a Two-Digit Number · 2

ANSWER

12

Subtracting from a Two-Digit Number · 1

ANSWER

33

Subtracting from a Two-Digit Number · 4

ANSWER

14

Subtracting from a Two-Digit Number · 3

ANSWER

30

Subtracting from a Two-Digit Number · 6

ANSWER

35

Subtracting from a Two-Digit Number · 5

ANSWER

26

Subtracting from a Two-Digit Number · 8

ANSWER

10

Subtracting from a Two-Digit Number · 7

ANSWER

36

Subtracting from a Two-Digit Number · 9

$16 - 5 = ___$

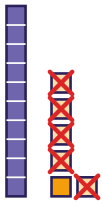

Subtracting from a Two-Digit Number · 10

$51 - 1 = ___$

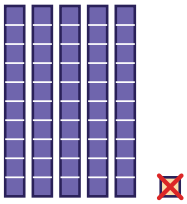

Subtracting from a Two-Digit Number · 11

$56 - 1 = ___$

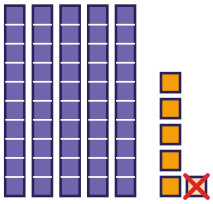

Subtracting from a Two-Digit Number · 12

The blocks show 16. 3 ones are crossed out. How many are left?

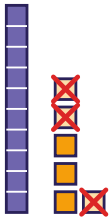

Subtracting from a Two-Digit Number · 13

5 ones − 5 ones = 0 ones.

The 4 tens stay. 45 − 5 = ___

Subtracting from a Two-Digit Number · 14

Subtract.

$$\begin{array}{r} 52 \\ ?\ \ 1 \\ \hline \end{array}$$

Subtracting from a Two-Digit Number · 15

Mia has 54 stickers and gives away 2. How many stickers does Mia have left?

Subtracting from a Two-Digit Number · 16

$48 - 3 = ___$

Subtracting from a Two-Digit Number · 10

ANSWER

50

Subtracting from a Two-Digit Number · 9

ANSWER

11

Subtracting from a Two-Digit Number · 12

ANSWER

13

Subtracting from a Two-Digit Number · 11

ANSWER

55

Subtracting from a Two-Digit Number · 14

ANSWER

51

Subtracting from a Two-Digit Number · 13

ANSWER

40

Subtracting from a Two-Digit Number · 16

ANSWER

45

Subtracting from a Two-Digit Number · 15

ANSWER

52

Subtracting from a Two-Digit Number · 17

$55 - 4 = ___$

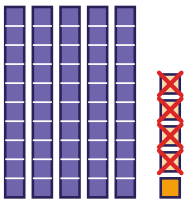

Subtracting from a Two-Digit Number · 18

$47 - 30 = ___$

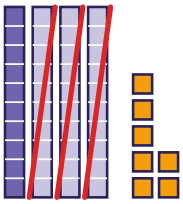

Subtracting from a Two-Digit Number · 19

$49 - 7 = ___$

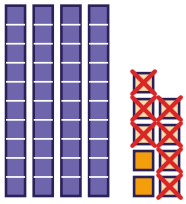

Subtracting from a Two-Digit Number · 20

The blocks show 72. 3 tens are crossed out. How many are left?

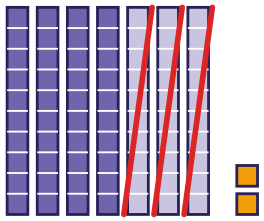

Subtracting from a Two-Digit Number · 21

1 one − 1 one = 0 ones. The 2 tens stay. 21 − 1 = ___

Subtracting from a Two-Digit Number · 22

Subtract.

$$\begin{array}{r} 47 \\ -\ 10 \\ \hline \end{array}$$

Subtracting from a Two-Digit Number · 23

Mia has 62 beads and gives away 2. How many beads does Mia have left?

Subtracting from a Two-Digit Number · 24

$41 - 40 = ___$

Subtracting from a Two-Digit Number · 18

ANSWER

17

Subtracting from a Two-Digit Number · 17

ANSWER

51

Subtracting from a Two-Digit Number · 20

ANSWER

42

Subtracting from a Two-Digit Number · 19

ANSWER

42

Subtracting from a Two-Digit Number · 22

ANSWER

37

Subtracting from a Two-Digit Number · 21

ANSWER

20

Subtracting from a Two-Digit Number · 24

ANSWER

1

Subtracting from a Two-Digit Number · 23

ANSWER

60