Task card 1 3D Shapes

How many corners (vertices) does this shape have?

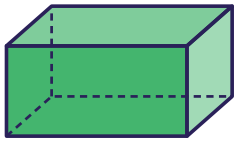

Task card 2 3D Shapes

Can this shape roll? Write yes or no.

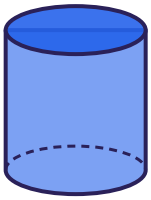

Task card 3 3D Shapes

Which 3D shape is a drum shaped like? Choose: cube, rectangular prism, sphere, cylinder, or cone.

Task card 4 3D Shapes

How many flat faces does this shape have?

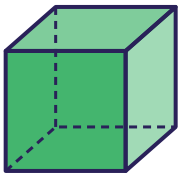

Task card 5 3D Shapes

Which 3D shape is a globe shaped like? Choose: cube, rectangular prism, sphere, cylinder, or cone.

Task card 6 3D Shapes

Which 3D shape is a ball shaped like? Choose: cube, rectangular prism, sphere, cylinder, or cone.

Task card 7 3D Shapes

Can this shape roll? Write yes or no.

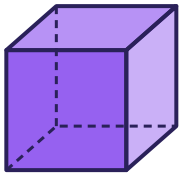

Task card 8 3D Shapes

Which 3D shape is an ice cream cone shaped like? Choose: cube, rectangular prism, sphere, cylinder, or cone.

Task card 9 3D Shapes

How many flat faces does this shape have?

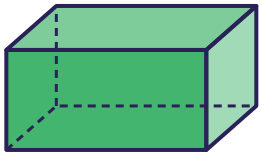

Task card 10 3D Shapes

How many flat faces does this shape have?

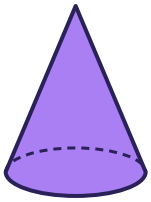

Task card 11 3D Shapes

Which 3D shape is a toy block shaped like? Choose: cube, rectangular prism, sphere, cylinder, or cone.

Task card 12 3D Shapes

Which 3D shape is a cereal box shaped like? Choose: cube, rectangular prism, sphere, cylinder, or cone.

Task card 13 3D Shapes

How many corners (vertices) does this shape have?

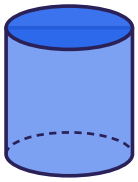

Task card 14 3D Shapes

Can this shape roll? Write yes or no.

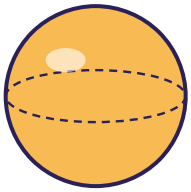

Task card 15 3D Shapes

Which 3D shape is a soup can shaped like? Choose: cube, rectangular prism, sphere, cylinder, or cone.

Task card 16 3D Shapes

How many corners (vertices) does this shape have?

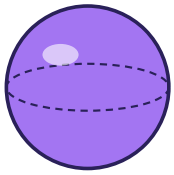

Task card 17 3D Shapes

How many flat faces does this shape have?

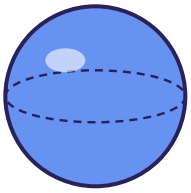

Task card 18 3D Shapes

Can this shape roll? Write yes or no.

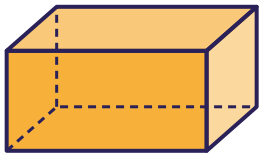

Task card 19 3D Shapes

Which 3D shape is a number cube (die) shaped like? Choose: cube, rectangular prism, sphere, cylinder, or cone.

Task card 20 3D Shapes

Which 3D shape is an orange shaped like? Choose: cube, rectangular prism, sphere, cylinder, or cone.

Task card 21 3D Shapes

Which 3D shape is a party hat shaped like? Choose: cube, rectangular prism, sphere, cylinder, or cone.

Task card 22 3D Shapes

How many corners (vertices) does this shape have?

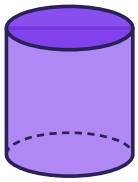

Task card 23 3D Shapes

Can this shape roll? Write yes or no.



Task card 24 3D Shapes

Can this shape roll? Write yes or no.

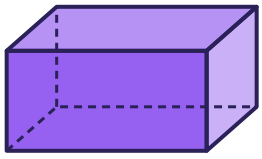

3D Shapes Task Cards

Recording sheet · Grade 1 · Look at the 3D shape and answer the question.

Name: _____ Date: _____

Scan to check your answers

1	2	3	4
5	6	7	8
9	10	11	12
13	14	15	16
17	18	19	20
21	22	23	24

3D Shapes Task Cards: Answer Key

Grade 1 · Hard

The answers online

1. 8	**2.** yes	**3.** cylinder
4. 6	**5.** sphere	**6.** sphere
7. no	**8.** cone	**9.** 6
10. 1	**11.** cube	**12.** rectangular prism
13. 0	**14.** yes	**15.** cylinder
16. 0	**17.** 0	**18.** no
19. cube	**20.** sphere	**21.** cone
22. 0	**23.** yes	**24.** no