3D Shapes · 1

How many flat faces does this shape have?

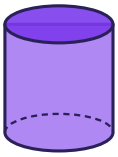

3D Shapes · 2

Can this shape roll? Write yes or no.

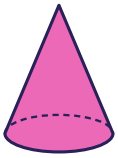

3D Shapes · 3

What is the name of this shape? Choose: cube, rectangular prism, sphere, cylinder, or cone.



3D Shapes · 4

Can this shape roll? Write yes or no.

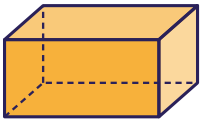

3D Shapes · 5

How many flat faces does this shape have?

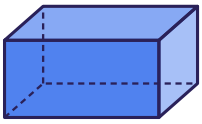

3D Shapes · 6

Can this shape roll? Write yes or no.

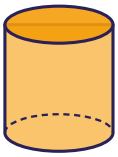

3D Shapes · 7

What is the name of this shape? Choose: cube, rectangular prism, sphere, cylinder, or cone.

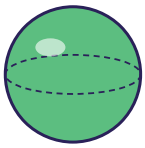

3D Shapes · 8

How many flat faces does this shape have?

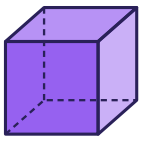

3D Shapes · 2

ANSWER

yes

3D Shapes · 1

ANSWER

2

3D Shapes · 4

ANSWER

no

3D Shapes · 3

ANSWER

cylinder

3D Shapes · 6

ANSWER

yes

3D Shapes · 5

ANSWER

6

3D Shapes · 8

ANSWER

6

3D Shapes · 7

ANSWER

sphere

3D Shapes · 9

What is the name of this shape? Choose: cube, rectangular prism, sphere, cylinder, or cone.

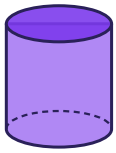

3D Shapes · 10

How many corners (vertices) does this shape have?

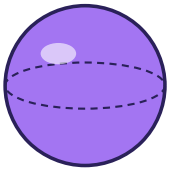

3D Shapes · 11

What is the name of this shape? Choose: cube, rectangular prism, sphere, cylinder, or cone.

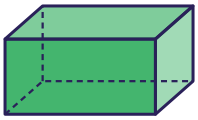

3D Shapes · 12

How many flat faces does this shape have?

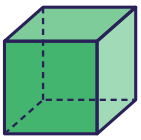

3D Shapes · 13

Which 3D shape is a drum shaped like? Choose: cube, rectangular prism, sphere, cylinder, or cone.

3D Shapes · 14

What is the name of this shape? Choose: cube, rectangular prism, sphere, cylinder, or cone.

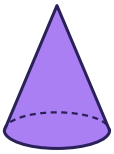

3D Shapes · 15

How many corners (vertices) does this shape have?

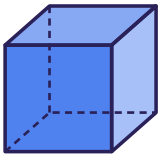

3D Shapes · 16

How many corners (vertices) does this shape have?

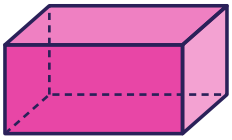

3D Shapes · 10

ANSWER

0

3D Shapes · 9

ANSWER

cylinder

3D Shapes · 12

ANSWER

6

3D Shapes · 11

ANSWER

rectangular prism

3D Shapes · 14

ANSWER

cone

3D Shapes · 13

ANSWER

cylinder

3D Shapes · 16

ANSWER

8

3D Shapes · 15

ANSWER

8

3D Shapes · 17

Which 3D shape is a ball shaped like? Choose: cube, rectangular prism, sphere, cylinder, or cone.

3D Shapes · 18

What is the name of this shape? Choose: cube, rectangular prism, sphere, cylinder, or cone.

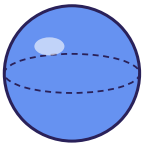

3D Shapes · 19

Which 3D shape is a number cube (die) shaped like? Choose: cube, rectangular prism, sphere, cylinder, or cone.

3D Shapes · 20

What is the name of this shape? Choose: cube, rectangular prism, sphere, cylinder, or cone.

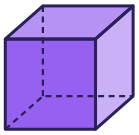

3D Shapes · 21

How many flat faces does this shape have?

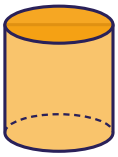

3D Shapes · 22

What is the name of this shape? Choose: cube, rectangular prism, sphere, cylinder, or cone.

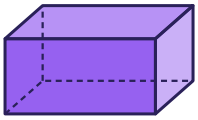

3D Shapes · 23

Which 3D shape is a cereal box shaped like? Choose: cube, rectangular prism, sphere, cylinder, or cone.

3D Shapes · 24

How many corners (vertices) does this shape have?

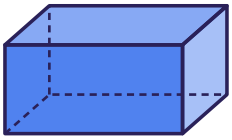

3D Shapes · 18

ANSWER

sphere

3D Shapes · 17

ANSWER

sphere

3D Shapes · 20

ANSWER

cube

3D Shapes · 19

ANSWER

cube

3D Shapes · 22

ANSWER

rectangular prism

3D Shapes · 21

ANSWER

2

3D Shapes · 24

ANSWER

8

3D Shapes · 23

ANSWER

rectangular prism