3D Shapes · 1

Can this shape roll? Write yes or no.

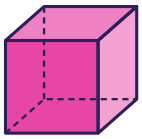

3D Shapes · 2

What is the name of this shape? Choose: cube, rectangular prism, sphere, cylinder, or cone.

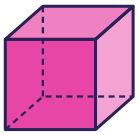

3D Shapes · 3

What is the name of this shape? Choose: cube, rectangular prism, sphere, cylinder, or cone.

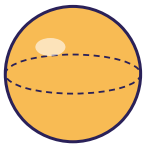

3D Shapes · 4

What is the name of this shape? Choose: cube, rectangular prism, sphere, cylinder, or cone.

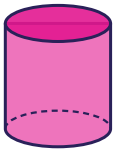

3D Shapes · 5

What is the name of this shape? Choose: cube, rectangular prism, sphere, cylinder, or cone.



3D Shapes · 6

Can this shape roll? Write yes or no.

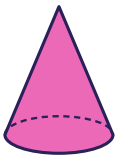

3D Shapes · 7

What is the name of this shape? Choose: cube, rectangular prism, sphere, cylinder, or cone.

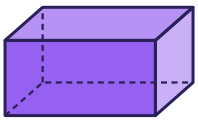

3D Shapes · 8

Can this shape roll? Write yes or no.

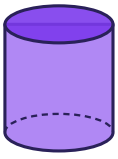

3D Shapes · 2

ANSWER

cube

3D Shapes · 1

ANSWER

no

3D Shapes · 4

ANSWER

cylinder

3D Shapes · 3

ANSWER

sphere

3D Shapes · 6

ANSWER

yes

3D Shapes · 5

ANSWER

cone

3D Shapes · 8

ANSWER

yes

3D Shapes · 7

ANSWER

rectangular prism

3D Shapes · 9

Can this shape roll? Write yes or no.

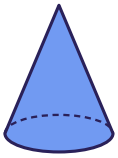

3D Shapes · 10

Can this shape roll? Write yes or no.

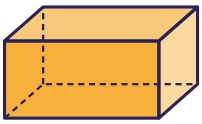

3D Shapes · 11

Can this shape roll? Write yes or no.

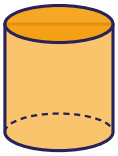

3D Shapes · 12

What is the name of this shape? Choose: cube, rectangular prism, sphere, cylinder, or cone.

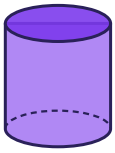

3D Shapes · 13

What is the name of this shape? Choose: cube, rectangular prism, sphere, cylinder, or cone.



3D Shapes · 14

Can this shape roll? Write yes or no.

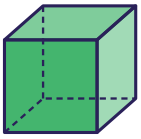

3D Shapes · 15

What is the name of this shape? Choose: cube, rectangular prism, sphere, cylinder, or cone.

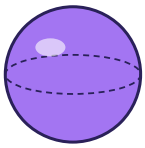

3D Shapes · 16

Can this shape roll? Write yes or no.

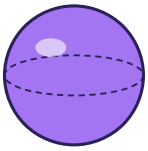

3D Shapes · 10

ANSWER

no

3D Shapes · 9

ANSWER

yes

3D Shapes · 12

ANSWER

cylinder

3D Shapes · 11

ANSWER

yes

3D Shapes · 14

ANSWER

no

3D Shapes · 13

ANSWER

cone

3D Shapes · 16

ANSWER

yes

3D Shapes · 15

ANSWER

sphere

3D Shapes · 17

What is the name of this shape? Choose: cube, rectangular prism, sphere, cylinder, or cone.

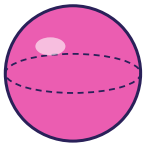

3D Shapes · 18

What is the name of this shape? Choose: cube, rectangular prism, sphere, cylinder, or cone.

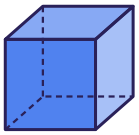

3D Shapes · 19

How many flat faces does this shape have?

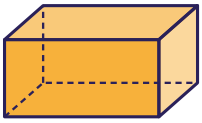

3D Shapes · 20

How many flat faces does this shape have?

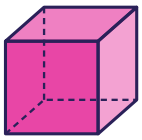

3D Shapes · 21

What is the name of this shape? Choose: cube, rectangular prism, sphere, cylinder, or cone.



3D Shapes · 22

What is the name of this shape? Choose: cube, rectangular prism, sphere, cylinder, or cone.

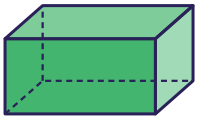

3D Shapes · 23

Can this shape roll? Write yes or no.

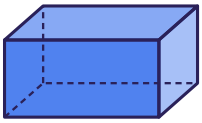

3D Shapes · 24

What is the name of this shape? Choose: cube, rectangular prism, sphere, cylinder, or cone.

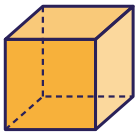

3D Shapes · 18

ANSWER

cube

3D Shapes · 17

ANSWER

sphere

3D Shapes · 20

ANSWER

6

3D Shapes · 19

ANSWER

6

3D Shapes · 22

ANSWER

rectangular prism

3D Shapes · 21

ANSWER

cylinder

3D Shapes · 24

ANSWER

cube

3D Shapes · 23

ANSWER

no