Task card 1 Reading a Clock

What time does the clock show?



Task card 2 Reading a Clock

What time does the clock show?



Task card 3 Reading a Clock

What time does the clock show?



Task card 4 Reading a Clock

Which number does the short hand point to?



Task card 5 Reading a Clock

Which number does the long hand point to?



Task card 6 Reading a Clock

It is half past ___.



Task card 7 Reading a Clock

Write 6 o'clock as a time with numbers.

Task card 8 Reading a Clock

At 10:30, which number does the long minute hand point to?

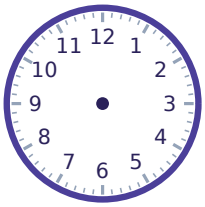

Task card 9 Reading a Clock

What time does the clock show?



Task card 10 Reading a Clock

What time does the clock show?



Task card 11 Reading a Clock

What time does the clock show?



Task card 12 Reading a Clock

Which number does the short hand point to?



Task card 13 Reading a Clock

Which number does the long hand point to?



Task card 14 Reading a Clock

It is half past ___.



Task card 15 Reading a Clock

Write half past 6 as a time with numbers.

Task card 16 Reading a Clock

At 12:30, which number does the long minute hand point to?

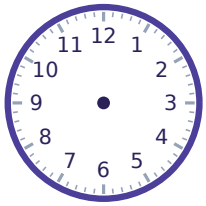

Task card 17 Reading a Clock

What time does the clock show?



Task card 18 Reading a Clock

What time does the clock show?



Task card 19 Reading a Clock

What time does the clock show?



Task card 20 Reading a Clock

Which number does the short hand point to?



Task card 21 Reading a Clock

Which number does the long hand point to?



Task card 22 Reading a Clock

It is half past ___.



Task card 23 Reading a Clock

Write 5 o'clock as a time with numbers.

Task card 24 Reading a Clock

At 11:00, which number does the long minute hand point to?

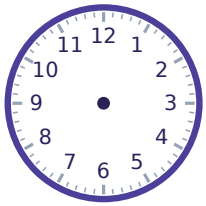

Reading a Clock Task Cards

Recording sheet · Grade 1 · Look at the clock hands. Write the time, like 3:00 or 3:30, or the number that is asked for.

Name: _____ Date: _____

Scan to check your answers

1	2	3	4
5	6	7	8
9	10	11	12
13	14	15	16
17	18	19	20
21	22	23	24

Reading a Clock Task Cards: Answer Key

Grade 1 · Hard

The answers online

1. 5:30	**2.** 6:30	**3.** 1:30
4. 9	**5.** 6	**6.** 9
7. 6:00	**8.** 6	**9.** 10:00
10. 4:30	**11.** 2:00	**12.** 8
13. 12	**14.** 7	**15.** 6:30
16. 6	**17.** 8:30	**18.** 6:00
19. 12:30	**20.** 12	**21.** 6
22. 5	**23.** 5:00	**24.** 12