**Task card 1** Reading a Clock

# What time does the clock show?




**Task card 2** Reading a Clock

# What time does the clock show?




**Task card 3** Reading a Clock

# What time does the clock show?




**Task card 4** Reading a Clock

## Which number does the short hand point to?




**Task card 5** Reading a Clock

## Which number does the long hand point to?




**Task card 6** Reading a Clock

# It is half past ___.



**Task card 7** Reading a Clock

Write 6 o'clock as a time with numbers.

**Task card 8** Reading a Clock

At 10:30, which number does the long minute hand point to?

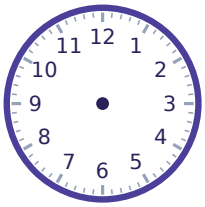


**Task card 9** Reading a Clock

What time does the clock show?




**Task card 10** Reading a Clock

What time does the clock show?




**Task card 11** Reading a Clock

What time does the clock show?




**Task card 12** Reading a Clock

Which number does the short hand point to?



**Task card 13** Reading a Clock

Which number does the long hand point to?




**Task card 14** Reading a Clock

It is half past ___.




**Task card 15** Reading a Clock

Write half past 6 as a time with numbers.

**Task card 16** Reading a Clock

At 12:30, which number does the long minute hand point to?

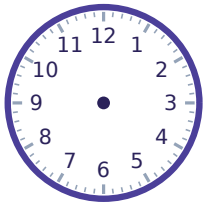


**Task card 17** Reading a Clock

What time does the clock show?




**Task card 18** Reading a Clock

What time does the clock show?



**Task card 19** Reading a Clock

# What time does the clock show?




**Task card 20** Reading a Clock

## Which number does the short hand point to?




**Task card 21** Reading a Clock

## Which number does the long hand point to?




**Task card 22** Reading a Clock

# It is half past ___.




**Task card 23** Reading a Clock

# Write 5 o'clock as a time with numbers.

**Task card 24** Reading a Clock

## At 11:00, which number does the long minute hand point to?

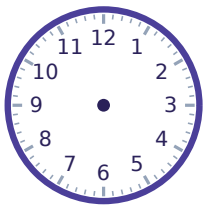

# Reading a Clock Task Cards

Recording sheet · Grade 1 · Look at the clock hands. Write the time, like 3:00 or 3:30, or the number that is asked for.

Scan to check your answers

Name: _____ Date: _____

| | | | |
|---|---|---|---|
| 1 | 2 | 3 | 4 |
| 5 | 6 | 7 | 8 |
| 9 | 10 | 11 | 12 |
| 13 | 14 | 15 | 16 |
| 17 | 18 | 19 | 20 |
| 21 | 22 | 23 | 24 |

# Reading a Clock Task Cards: Answer Key

Grade 1 · Hard

The answers online

| | | |
|---|---|---|
| **1.** 5:30 | **2.** 6:30 | **3.** 1:30 |
| **4.** 9 | **5.** 6 | **6.** 9 |
| **7.** 6:00 | **8.** 6 | **9.** 10:00 |
| **10.** 4:30 | **11.** 2:00 | **12.** 8 |
| **13.** 12 | **14.** 7 | **15.** 6:30 |
| **16.** 6 | **17.** 8:30 | **18.** 6:00 |
| **19.** 12:30 | **20.** 12 | **21.** 6 |
| **22.** 5 | **23.** 5:00 | **24.** 12 |