Reading a Clock · 1

What time does the clock show?



Reading a Clock · 2

What time does the clock show?



Reading a Clock · 3

What time does the clock show?



Reading a Clock · 4

Which number does the short hand point to?



Reading a Clock · 5

Which number does the long hand point to?



Reading a Clock · 6

It is half past ___.



Reading a Clock · 7

Write 6 o'clock as a time with numbers.

Reading a Clock · 8

At 10:30, which number does the long minute hand point to?

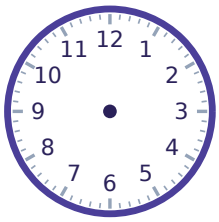

Reading a Clock · 2

ANSWER

6:30

Reading a Clock · 1

ANSWER

5:30

Reading a Clock · 4

ANSWER

9

Reading a Clock · 3

ANSWER

1:30

Reading a Clock · 6

ANSWER

9

Reading a Clock · 5

ANSWER

6

Reading a Clock · 8

ANSWER

6

Reading a Clock · 7

ANSWER

6:00

Reading a Clock · 9

What time does the clock show?



Reading a Clock · 10

What time does the clock show?



Reading a Clock · 11

What time does the clock show?



Reading a Clock · 12

Which number does the short hand point to?



Reading a Clock · 13

Which number does the long hand point to?



Reading a Clock · 14

It is half past ___.



Reading a Clock · 15

Write half past 6 as a time with numbers.

Reading a Clock · 16

At 12:30, which number does the long minute hand point to?

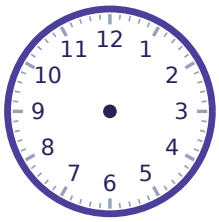

Reading a Clock · 10

ANSWER

4:30

Reading a Clock · 9

ANSWER

10:00

Reading a Clock · 12

ANSWER

8

Reading a Clock · 11

ANSWER

2:00

Reading a Clock · 14

ANSWER

7

Reading a Clock · 13

ANSWER

12

Reading a Clock · 16

ANSWER

6

Reading a Clock · 15

ANSWER

6:30

Reading a Clock · 17

What time does the clock show?



Reading a Clock · 18

What time does the clock show?



Reading a Clock · 19

What time does the clock show?



Reading a Clock · 20

Which number does the short hand point to?



Reading a Clock · 21

Which number does the long hand point to?



Reading a Clock · 22

It is half past ___.



Reading a Clock · 23

Write 5 o'clock as a time with numbers.

Reading a Clock · 24

At 11:00, which number does the long minute hand point to?

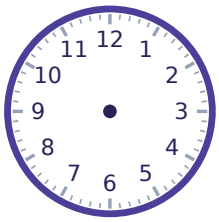

Reading a Clock · 18

ANSWER

6:00

Reading a Clock · 17

ANSWER

8:30

Reading a Clock · 20

ANSWER

12

Reading a Clock · 19

ANSWER

12:30

Reading a Clock · 22

ANSWER

5

Reading a Clock · 21

ANSWER

6

Reading a Clock · 24

ANSWER

12

Reading a Clock · 23

ANSWER

5:00