Reading a Clock · 1

What time does the clock show?




Reading a Clock · 2

What time does the clock show?




Reading a Clock · 3

What time does the clock show?




Reading a Clock · 4

Which number does the short hand point to?




Reading a Clock · 5

Which number does the long hand point to?




Reading a Clock · 6

It is half past ___.




Reading a Clock · 7

Write 6 o'clock as a time with numbers.

Reading a Clock · 8

At 10:30, which number does the long minute hand point to?

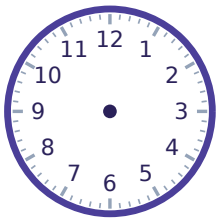

Reading a Clock · 2

**ANSWER**

**6:30**

Reading a Clock · 1

**ANSWER**

**5:30**

Reading a Clock · 4

**ANSWER**

**9**

Reading a Clock · 3

**ANSWER**

**1:30**

Reading a Clock · 6

**ANSWER**

**9**

Reading a Clock · 5

**ANSWER**

**6**

Reading a Clock · 8

**ANSWER**

**6**

Reading a Clock · 7

**ANSWER**

**6:00**

Reading a Clock · 9

What time does the clock show?




Reading a Clock · 10

What time does the clock show?




Reading a Clock · 11

What time does the clock show?




Reading a Clock · 12

Which number does the short hand point to?




Reading a Clock · 13

Which number does the long hand point to?




Reading a Clock · 14

It is half past ___.




Reading a Clock · 15

Write half past 6 as a time with numbers.

Reading a Clock · 16

At 12:30, which number does the long minute hand point to?

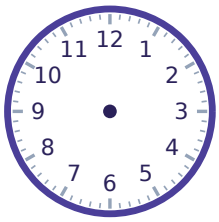

Reading a Clock · 10

**ANSWER**

# 4:30

Reading a Clock · 9

**ANSWER**

# 10:00

Reading a Clock · 12

**ANSWER**

# 8

Reading a Clock · 11

**ANSWER**

# 2:00

Reading a Clock · 14

**ANSWER**

# 7

Reading a Clock · 13

**ANSWER**

# 12

Reading a Clock · 16

**ANSWER**

# 6

Reading a Clock · 15

**ANSWER**

# 6:30

Reading a Clock · 17

What time does the clock show?




Reading a Clock · 18

What time does the clock show?




Reading a Clock · 19

What time does the clock show?




Reading a Clock · 20

Which number does the short hand point to?




Reading a Clock · 21

Which number does the long hand point to?




Reading a Clock · 22

It is half past ___.




Reading a Clock · 23

Write 5 o'clock as a time with numbers.

Reading a Clock · 24

At 11:00, which number does the long minute hand point to?

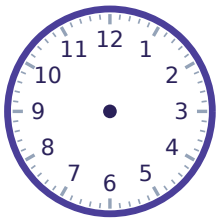

Reading a Clock · 18

**ANSWER**

**6:00**

Reading a Clock · 17

**ANSWER**

**8:30**

Reading a Clock · 20

**ANSWER**

**12**

Reading a Clock · 19

**ANSWER**

**12:30**

Reading a Clock · 22

**ANSWER**

**5**

Reading a Clock · 21

**ANSWER**

**6**

Reading a Clock · 24

**ANSWER**

**12**

Reading a Clock · 23

**ANSWER**

**5:00**