Picture Counting to 20 · 1

How many are there?



Picture Counting to 20 · 2

How many are there?



Picture Counting to 20 · 3

How many are there?



Picture Counting to 20 · 4

How many dots are there?

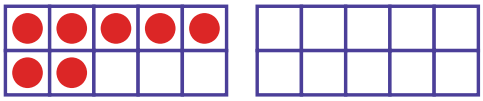

Picture Counting to 20 · 5

How many hearts are there?



Picture Counting to 20 · 6

How many stars are there?



Picture Counting to 20 · 7

How many pictures are there in all?



Picture Counting to 20 · 8

Count the balloons. Then draw 1 more. How many are there now?



Picture Counting to 20 · 2

ANSWER

5

Picture Counting to 20 · 1

ANSWER

5

Picture Counting to 20 · 4

ANSWER

7

Picture Counting to 20 · 3

ANSWER

6

Picture Counting to 20 · 6

ANSWER

3

Picture Counting to 20 · 5

ANSWER

6

Picture Counting to 20 · 8

ANSWER

4

Picture Counting to 20 · 7

ANSWER

6

Picture Counting to 20 · 9

How many are there?



Picture Counting to 20 · 10

How many are there?



Picture Counting to 20 · 11

How many are there?



Picture Counting to 20 · 12

How many dots are there?

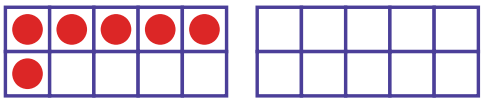

Picture Counting to 20 · 13

How many stars are there?



Picture Counting to 20 · 14

How many apples are there?



Picture Counting to 20 · 15

How many pictures are there in all?



Picture Counting to 20 · 16

Count the balloons. Then draw 1 more. How many are there now?



Picture Counting to 20 · 10

ANSWER

1

Picture Counting to 20 · 9

ANSWER

5

Picture Counting to 20 · 12

ANSWER

6

Picture Counting to 20 · 11

ANSWER

1

Picture Counting to 20 · 14

ANSWER

2

Picture Counting to 20 · 13

ANSWER

2

Picture Counting to 20 · 16

ANSWER

5

Picture Counting to 20 · 15

ANSWER

10

Picture Counting to 20 · 17

How many are there?



Picture Counting to 20 · 18

How many are there?



Picture Counting to 20 · 19

How many are there?



Picture Counting to 20 · 20

How many dots are there?

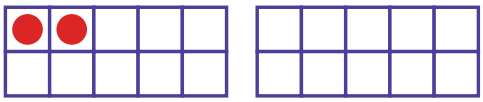

Picture Counting to 20 · 21

How many apples are there?



Picture Counting to 20 · 22

How many hearts are there?



Picture Counting to 20 · 23

How many pictures are there in all?



Picture Counting to 20 · 24

Count the apples. Then draw 1 more. How many are there now?



Picture Counting to 20 · 18

ANSWER

10

Picture Counting to 20 · 17

ANSWER

7

Picture Counting to 20 · 20

ANSWER

2

Picture Counting to 20 · 19

ANSWER

7

Picture Counting to 20 · 22

ANSWER

1

Picture Counting to 20 · 21

ANSWER

1

Picture Counting to 20 · 24

ANSWER

10

Picture Counting to 20 · 23

ANSWER

10