Measuring Length · 1

A toy train is 7 inches long and a pencil is 7 inches long. What is their total length in inches?



Measuring Length · 2

A crayon is 1 inch long and a book is 3 inches long. How many inches longer is the longer one?



Measuring Length · 3

A pencil is 3 inches long and a crayon is 1 inch long. What is their total length in inches?



Measuring Length · 4

A crayon is 3 inches long and a ribbon is 4 inches long. How many inches longer is the longer one?



Measuring Length · 5

A pencil is 3 inches long and a ribbon is 1 inch long. What is their total length in inches?



Measuring Length · 6

A toy train is 2 inches long and a book is 6 inches long. How many inches longer is the longer one?



Measuring Length · 7

A ribbon is 8 inches long and a pencil is 1 inch long. What is their total length in inches?



Measuring Length · 8

A crayon is 7 inches long and a shoelace is 8 inches long. How many inches longer is the longer one?



Measuring Length · 2

ANSWER

2

Measuring Length · 1

ANSWER

14

Measuring Length · 4

ANSWER

1

Measuring Length · 3

ANSWER

4

Measuring Length · 6

ANSWER

4

Measuring Length · 5

ANSWER

4

Measuring Length · 8

ANSWER

1

Measuring Length · 7

ANSWER

9

Measuring Length · 9

A ribbon is 8 inches long and a book is 4 inches long. What is their total length in inches?



Measuring Length · 10

A book is 7 inches long and a shoelace is 8 inches long. How many inches longer is the longer one?



Measuring Length · 11

A book is 4 inches long and a toy train is 1 inch long. What is their total length in inches?



Measuring Length · 12

A toy train is 9 inches long and a crayon is 1 inch long. How many inches longer is the longer one?



Measuring Length · 13

A ribbon is 10 inches long and a toy train is 4 inches long. What is their total length in inches?



Measuring Length · 14

A crayon is 1 inch long and a pencil is 10 inches long. How many inches longer is the longer one?



Measuring Length · 15

A ribbon is 6 inches long and a book is 9 inches long. What is their total length in inches?



Measuring Length · 16

A shoelace is 1 inch long and a ribbon is 3 inches long. How many inches longer is the longer one?



Measuring Length · 10

ANSWER

1

Measuring Length · 9

ANSWER

12

Measuring Length · 12

ANSWER

8

Measuring Length · 11

ANSWER

5

Measuring Length · 14

ANSWER

9

Measuring Length · 13

ANSWER

14

Measuring Length · 16

ANSWER

2

Measuring Length · 15

ANSWER

15

Measuring Length · 17

A shoelace is 2 inches long and a crayon is 2 inches long. What is their total length in inches?



Measuring Length · 18

A toy train is 10 inches long and a pencil is 4 inches long. How many inches longer is the longer one?



Measuring Length · 19

A pencil is 9 inches long and a ribbon is 8 inches long. What is their total length in inches?



Measuring Length · 20

A toy train is 8 inches long and a ribbon is 3 inches long. How many inches longer is the longer one?



Measuring Length · 21

A book is 11 inches long and a pencil is 11 inches long. What is their total length in inches?



Measuring Length · 22

A book is 4 inches long and a crayon is 7 inches long. How many inches longer is the longer one?



Measuring Length · 23

A crayon is 6 inches long and a shoelace is 5 inches long. What is their total length in inches?



Measuring Length · 24

A toy train is 7 inches long and a ribbon is 10 inches long. How many inches longer is the longer one?



Measuring Length · 18

ANSWER

6

Measuring Length · 17

ANSWER

4

Measuring Length · 20

ANSWER

5

Measuring Length · 19

ANSWER

17

Measuring Length · 22

ANSWER

3

Measuring Length · 21

ANSWER

22

Measuring Length · 24

ANSWER

3

Measuring Length · 23

ANSWER

11