Make a Ten to Add · 1

$2 + ___ = 10$

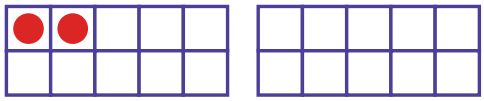

Make a Ten to Add · 2

$9 + 6 = 10 + ___$

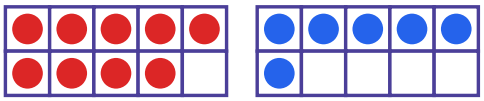

Make a Ten to Add · 3

$8 + 9 = ___$

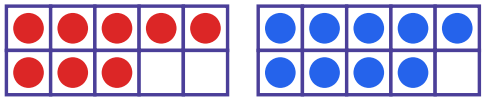

Make a Ten to Add · 4

How many boxes are empty?

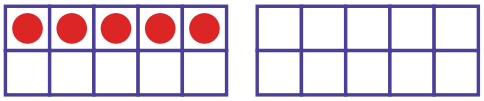

Make a Ten to Add · 5

Move dots to fill the first frame. How many dots in all?

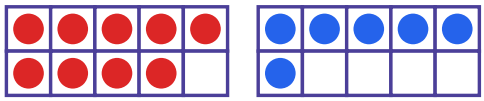

Make a Ten to Add · 6

7 + 8: how many does 7 need to make 10?

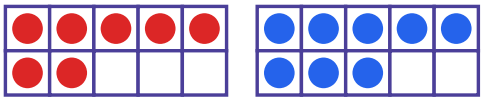

Make a Ten to Add · 7

Make a ten: 7 + 3 = 10, and 3 more.

7 + 6 = ___

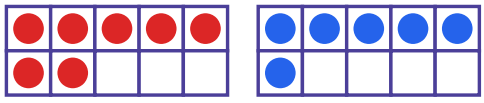

Make a Ten to Add · 8

Zoe has 8 beads and gets 7 more. How many beads does Zoe have now?

Make a Ten to Add · 2

ANSWER

5

Make a Ten to Add · 1

ANSWER

8

Make a Ten to Add · 4

ANSWER

5

Make a Ten to Add · 3

ANSWER

17

Make a Ten to Add · 6

ANSWER

3

Make a Ten to Add · 5

ANSWER

15

Make a Ten to Add · 8

ANSWER

15

Make a Ten to Add · 7

ANSWER

13

Make a Ten to Add · 9

$8 + 4 = 10 + ___$

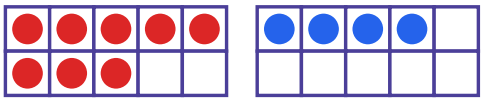

Make a Ten to Add · 10

$6 + 5 = ___$

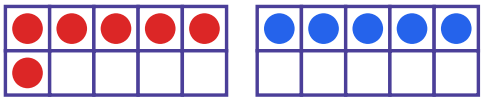

Make a Ten to Add · 11

$8 + 7 = ___$

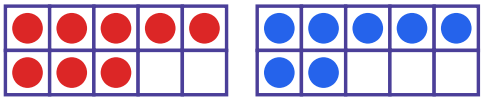

Make a Ten to Add · 12

Move dots to fill the first frame. How many dots in all?

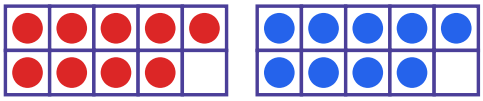

Make a Ten to Add · 13

6 + 7: how many does 6 need to make 10?

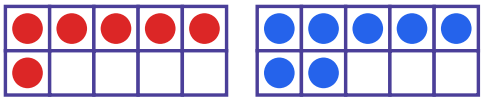

Make a Ten to Add · 14

9 + 1 = 10. Take 1 from 3. How many are left?

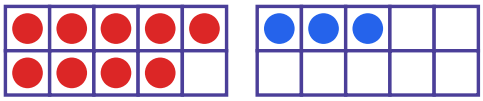

Make a Ten to Add · 15

Make a ten: 7 + 3 = 10, and 6 more.

$7 + 9 = ___$

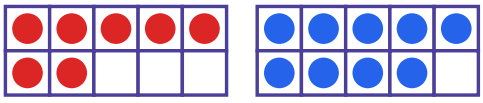

Make a Ten to Add · 16

Max has 6 crayons and gets 8 more. How many crayons does Max have now?

Make a Ten to Add · 10

ANSWER

11

Make a Ten to Add · 9

ANSWER

2

Make a Ten to Add · 12

ANSWER

18

Make a Ten to Add · 11

ANSWER

15

Make a Ten to Add · 14

ANSWER

2

Make a Ten to Add · 13

ANSWER

4

Make a Ten to Add · 16

ANSWER

14

Make a Ten to Add · 15

ANSWER

16

Make a Ten to Add · 17

$7 + 4 = 10 + ___$

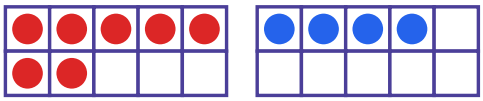

Make a Ten to Add · 18

$8 + 4 = ___$

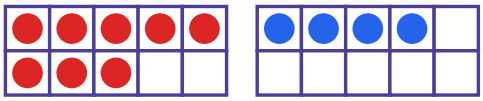

Make a Ten to Add · 19

Move dots to fill the first frame. How many dots in all?

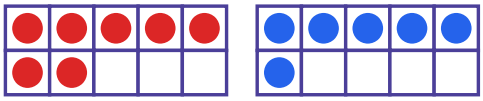

Make a Ten to Add · 20

6 + 4 = 10. Take 4 from 9. How many are left?

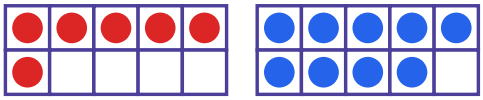

Make a Ten to Add · 21

Make a ten: 7 + 3 = 10, and 2 more.

7 + 5 = ___

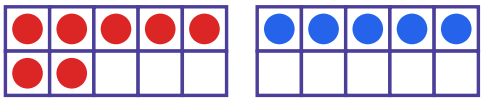

Make a Ten to Add · 22

Sam has 6 buttons and gets 5 more. How many buttons does Sam have now?

Make a Ten to Add · 23

$1 + ___ = 10$

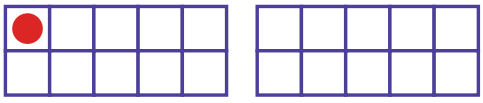

Make a Ten to Add · 24

$8 + 5 = 10 + ___$

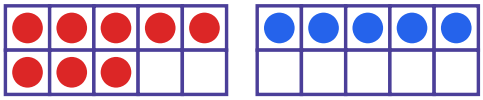

Make a Ten to Add · 18

ANSWER

12

Make a Ten to Add · 17

ANSWER

1

Make a Ten to Add · 20

ANSWER

5

Make a Ten to Add · 19

ANSWER

13

Make a Ten to Add · 22

ANSWER

11

Make a Ten to Add · 21

ANSWER

12

Make a Ten to Add · 24

ANSWER

3

Make a Ten to Add · 23

ANSWER

9