Make a Ten to Add · 1

$2 + ___ = 10$

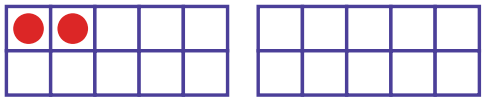

Make a Ten to Add · 2

$9 + 6 = 10 + ___$

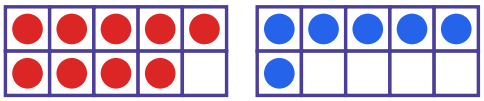

Make a Ten to Add · 3

$8 + 9 = ___$

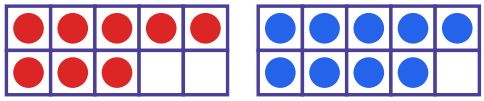

Make a Ten to Add · 4

How many boxes are empty?

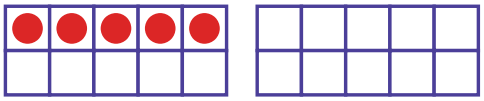

Make a Ten to Add · 5

Move dots to fill the first frame. How many dots in all?

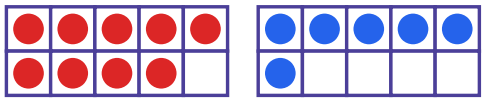

Make a Ten to Add · 6

7 + 8: how many does 7 need to make 10?

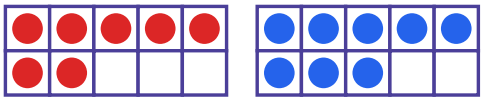

Make a Ten to Add · 7

Make a ten: 7 + 3 = 10, and 3 more.

7 + 6 = ___

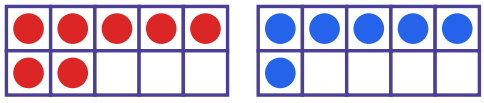

Make a Ten to Add · 8

Zoe has 8 beads and gets 7 more. How many beads does Zoe have now?

Make a Ten to Add · 2

**ANSWER**

**5**

Make a Ten to Add · 1

**ANSWER**

**8**

Make a Ten to Add · 4

**ANSWER**

**5**

Make a Ten to Add · 3

**ANSWER**

**17**

Make a Ten to Add · 6

**ANSWER**

**3**

Make a Ten to Add · 5

**ANSWER**

**15**

Make a Ten to Add · 8

**ANSWER**

**15**

Make a Ten to Add · 7

**ANSWER**

**13**

Make a Ten to Add · 9

$8 + 4 = 10 + ___$

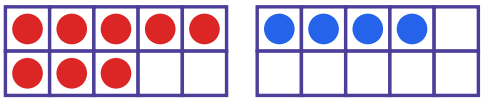

Make a Ten to Add · 10

$6 + 5 = ___$

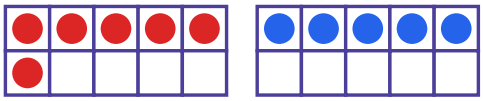

Make a Ten to Add · 11

$8 + 7 = ___$

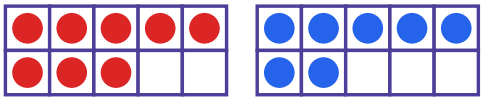

Make a Ten to Add · 12

Move dots to fill the first frame. How many dots in all?

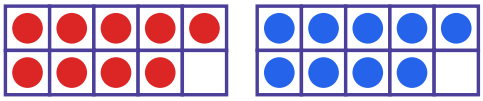

Make a Ten to Add · 13

6 + 7: how many does 6 need to make 10?

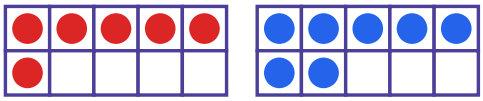

Make a Ten to Add · 14

9 + 1 = 10. Take 1 from 3. How many are left?

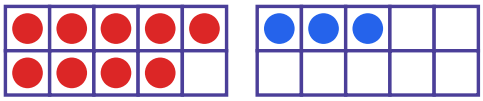

Make a Ten to Add · 15

Make a ten: 7 + 3 = 10, and 6 more.

$7 + 9 = ___$

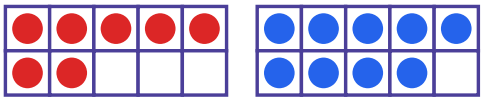

Make a Ten to Add · 16

Max has 6 crayons and gets 8 more. How many crayons does Max have now?

Make a Ten to Add · 10

**ANSWER**

# 11

Make a Ten to Add · 9

**ANSWER**

# 2

Make a Ten to Add · 12

**ANSWER**

# 18

Make a Ten to Add · 11

**ANSWER**

# 15

Make a Ten to Add · 14

**ANSWER**

# 2

Make a Ten to Add · 13

**ANSWER**

# 4

Make a Ten to Add · 16

**ANSWER**

# 14

Make a Ten to Add · 15

**ANSWER**

# 16

Make a Ten to Add · 17

$7 + 4 = 10 + ___$

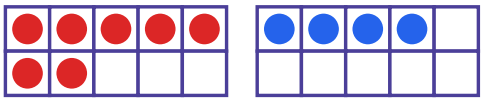

Make a Ten to Add · 18

$8 + 4 = ___$

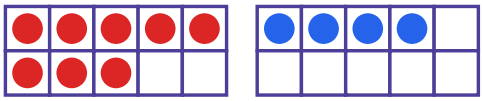

Make a Ten to Add · 19

Move dots to fill the first frame. How many dots in all?

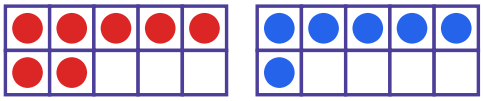

Make a Ten to Add · 20

6 + 4 = 10. Take 4 from 9. How many are left?

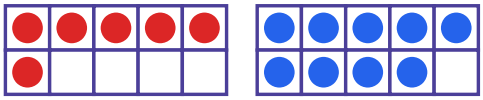

Make a Ten to Add · 21

Make a ten: 7 + 3 = 10, and 2 more.

7 + 5 = ___

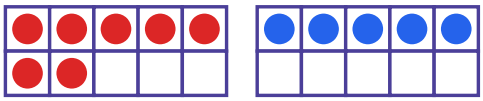

Make a Ten to Add · 22

Sam has 6 buttons and gets 5 more. How many buttons does Sam have now?

Make a Ten to Add · 23

$1 + ___ = 10$

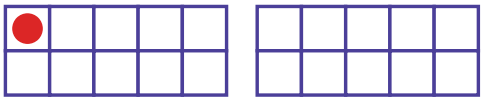

Make a Ten to Add · 24

$8 + 5 = 10 + ___$

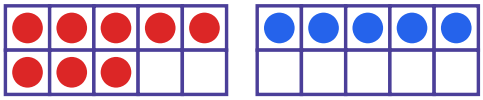

Make a Ten to Add · 18

**ANSWER**

**12**

Make a Ten to Add · 17

**ANSWER**

**1**

Make a Ten to Add · 20

**ANSWER**

**5**

Make a Ten to Add · 19

**ANSWER**

**13**

Make a Ten to Add · 22

**ANSWER**

**11**

Make a Ten to Add · 21

**ANSWER**

**12**

Make a Ten to Add · 24

**ANSWER**

**3**

Make a Ten to Add · 23

**ANSWER**

**9**