Halves & Fourths · 1

# How many halves make one whole?

Halves & Fourths · 2

How many fourths are shaded?



Halves & Fourths · 3

Both pizzas are the same size. Which piece is smaller, one half or one fourth? Write half or fourth.

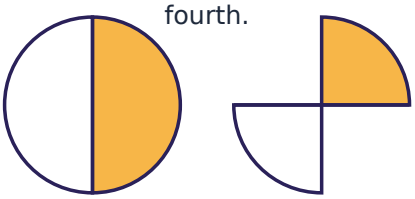

Halves & Fourths · 4

How many fourths are shaded?

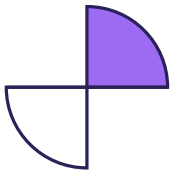

Halves & Fourths · 5

The shaded part is one ___ of the shape. Write half or fourth.



Halves & Fourths · 6

How many fourths are shaded?



Halves & Fourths · 7

Both pizzas are the same size. Which piece is bigger, one half or one fourth? Write half or fourth.

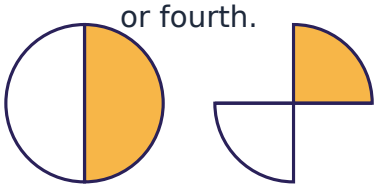

Halves & Fourths · 8

The shaded part is one ___ of the shape. Write half or fourth.



Halves & Fourths · 2

**ANSWER**

# 4

Halves & Fourths · 1

**ANSWER**

# 2

Halves & Fourths · 4

**ANSWER**

# 1

Halves & Fourths · 3

**ANSWER**

# fourth

Halves & Fourths · 6

**ANSWER**

# 4

Halves & Fourths · 5

**ANSWER**

# half

Halves & Fourths · 8

**ANSWER**

# fourth

Halves & Fourths · 7

**ANSWER**

# half

Halves & Fourths · 9

The shaded part is one ___ of the shape. Write half or fourth.

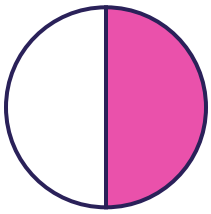

Halves & Fourths · 10

How many fourths are shaded?



Halves & Fourths · 11

How many fourths are shaded?



Halves & Fourths · 12

How many fourths are shaded?



Halves & Fourths · 13

How many fourths are shaded?



Halves & Fourths · 14

How many fourths are shaded?



Halves & Fourths · 15

How many fourths make one whole?

Halves & Fourths · 16

The shaded part is one ___ of the shape. Write half or fourth.



Halves & Fourths · 10

**ANSWER**

**2**

Halves & Fourths · 9

**ANSWER**

**half**

Halves & Fourths · 12

**ANSWER**

**1**

Halves & Fourths · 11

**ANSWER**

**2**

Halves & Fourths · 14

**ANSWER**

**4**

Halves & Fourths · 13

**ANSWER**

**4**

Halves & Fourths · 16

**ANSWER**

**fourth**

Halves & Fourths · 15

**ANSWER**

**4**

Halves & Fourths · 17

How many fourths are shaded?



Halves & Fourths · 18

How many fourths are shaded?



Halves & Fourths · 19

The shaded part is one ___ of the shape. Write half or fourth.



Halves & Fourths · 20

How many fourths are shaded?



Halves & Fourths · 21

How many fourths are shaded?



Halves & Fourths · 22

How many fourths are shaded?



Halves & Fourths · 23

How many fourths are shaded?



Halves & Fourths · 24

The shaded part is one ___ of the shape. Write half or fourth.



Halves & Fourths · 18

**ANSWER**

**4**

Halves & Fourths · 17

**ANSWER**

**1**

Halves & Fourths · 20

**ANSWER**

**3**

Halves & Fourths · 19

**ANSWER**

**fourth**

Halves & Fourths · 22

**ANSWER**

**1**

Halves & Fourths · 21

**ANSWER**

**4**

Halves & Fourths · 24

**ANSWER**

**half**

Halves & Fourths · 23

**ANSWER**

**2**