Halves & Fourths · 1

Are the parts equal? Write yes or no.



Halves & Fourths · 2

How many equal parts is this shape cut into?



Halves & Fourths · 3

The shaded part is one ___ of the shape. Write half or fourth.



Halves & Fourths · 4

Are the parts equal? Write yes or no.



Halves & Fourths · 5

How many equal parts is this shape cut into?



Halves & Fourths · 6

Are the parts equal? Write yes or no.



Halves & Fourths · 7

How many equal parts is this shape cut into?

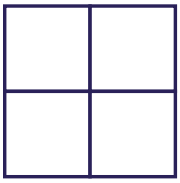

Halves & Fourths · 8

Are the parts equal? Write yes or no.



Halves & Fourths · 2

ANSWER

2

Halves & Fourths · 1

ANSWER

yes

Halves & Fourths · 4

ANSWER

no

Halves & Fourths · 3

ANSWER

fourth

Halves & Fourths · 6

ANSWER

no

Halves & Fourths · 5

ANSWER

2

Halves & Fourths · 8

ANSWER

no

Halves & Fourths · 7

ANSWER

4

Halves & Fourths · 9

The shaded part is one ___ of the shape. Write half or fourth.



Halves & Fourths · 10

How many fourths are shaded?



Halves & Fourths · 11

The shaded part is one ___ of the shape. Write half or fourth.



Halves & Fourths · 12

Are the parts equal? Write yes or no.



Halves & Fourths · 13

How many fourths are shaded?



Halves & Fourths · 14

How many fourths are shaded?



Halves & Fourths · 15

Are the parts equal? Write yes or no.



Halves & Fourths · 16

How many fourths are shaded?



Halves & Fourths · 10

ANSWER

1

Halves & Fourths · 9

ANSWER

half

Halves & Fourths · 12

ANSWER

yes

Halves & Fourths · 11

ANSWER

fourth

Halves & Fourths · 14

ANSWER

4

Halves & Fourths · 13

ANSWER

2

Halves & Fourths · 16

ANSWER

1

Halves & Fourths · 15

ANSWER

yes

Halves & Fourths · 17

The shaded part is one ___ of the shape. Write half or fourth.



Halves & Fourths · 18

The shaded part is one ___ of the shape. Write half or fourth.

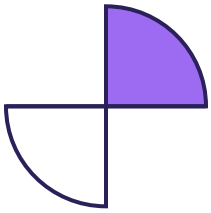

Halves & Fourths · 19

The shaded part is one ___ of the shape. Write half or fourth.

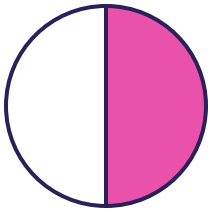

Halves & Fourths · 20

How many fourths are shaded?



Halves & Fourths · 21

Are the parts equal? Write yes or no.



Halves & Fourths · 22

The shaded part is one ___ of the shape. Write half or fourth.



Halves & Fourths · 23

The shaded part is one ___ of the shape. Write half or fourth.



Halves & Fourths · 24

How many equal parts is this shape cut into?



Halves & Fourths · 18

ANSWER

fourth

Halves & Fourths · 17

ANSWER

fourth

Halves & Fourths · 20

ANSWER

3

Halves & Fourths · 19

ANSWER

half

Halves & Fourths · 22

ANSWER

fourth

Halves & Fourths · 21

ANSWER

yes

Halves & Fourths · 24

ANSWER

4

Halves & Fourths · 23

ANSWER

half