Halves & Fourths · 1

How many equal parts is this shape cut into?



Halves & Fourths · 2

Are the parts equal? Write yes or no.



Halves & Fourths · 3

Are the parts equal? Write yes or no.



Halves & Fourths · 4

Are the parts equal? Write yes or no.



Halves & Fourths · 5

Are the parts equal? Write yes or no.



Halves & Fourths · 6

Are the parts equal? Write yes or no.



Halves & Fourths · 7

How many equal parts is this shape cut into?

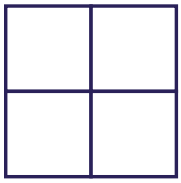

Halves & Fourths · 8

How many equal parts is this shape cut into?



Halves & Fourths · 2

ANSWER

yes

Halves & Fourths · 1

ANSWER

4

Halves & Fourths · 4

ANSWER

yes

Halves & Fourths · 3

ANSWER

no

Halves & Fourths · 6

ANSWER

yes

Halves & Fourths · 5

ANSWER

yes

Halves & Fourths · 8

ANSWER

4

Halves & Fourths · 7

ANSWER

4

Halves & Fourths · 9

Are the parts equal? Write yes or no.



Halves & Fourths · 10

Are the parts equal? Write yes or no.



Halves & Fourths · 11

How many equal parts is this shape cut into?



Halves & Fourths · 12

Are the parts equal? Write yes or no.



Halves & Fourths · 13

The shaded part is one ___ of the shape. Write half or fourth.



Halves & Fourths · 14

Are the parts equal? Write yes or no.



Halves & Fourths · 15

The shaded part is one ___ of the shape. Write half or fourth.

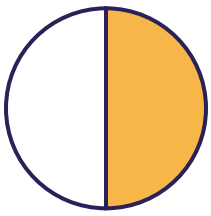

Halves & Fourths · 16

The shaded part is one ___ of the shape. Write half or fourth.



Halves & Fourths · 10

ANSWER

no

Halves & Fourths · 9

ANSWER

no

Halves & Fourths · 12

ANSWER

no

Halves & Fourths · 11

ANSWER

2

Halves & Fourths · 14

ANSWER

yes

Halves & Fourths · 13

ANSWER

fourth

Halves & Fourths · 16

ANSWER

half

Halves & Fourths · 15

ANSWER

half

Halves & Fourths · 17

How many equal parts is this shape cut into?



Halves & Fourths · 18

How many equal parts is this shape cut into?



Halves & Fourths · 19

Are the parts equal? Write yes or no.

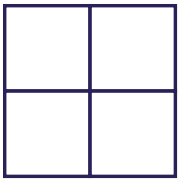

Halves & Fourths · 20

The shaded part is one ___ of the shape. Write half or fourth.

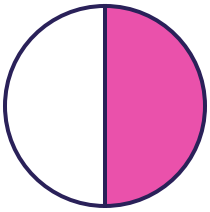

Halves & Fourths · 21

The shaded part is one ___ of the shape. Write half or fourth.



Halves & Fourths · 22

The shaded part is one ___ of the shape. Write half or fourth.



Halves & Fourths · 23

The shaded part is one ___ of the shape. Write half or fourth.



Halves & Fourths · 24

The shaded part is one ___ of the shape. Write half or fourth.



Halves & Fourths · 18

ANSWER

2

Halves & Fourths · 17

ANSWER

2

Halves & Fourths · 20

ANSWER

half

Halves & Fourths · 19

ANSWER

yes

Halves & Fourths · 22

ANSWER

fourth

Halves & Fourths · 21

ANSWER

half

Halves & Fourths · 24

ANSWER

fourth

Halves & Fourths · 23

ANSWER

half