Task card 1 Doubles & Near Doubles

$7 + 7 = ___$

Task card 2 Doubles & Near Doubles

$5 + 4 = ___$ Think: 4 + 4, then add 1.

Task card 3 Doubles & Near Doubles

$8 + 9 = ___$ Think: 8 + 8, then add 1.

Task card 4 Doubles & Near Doubles

$2 + 3 = ___$ Count the dots, or use a double.

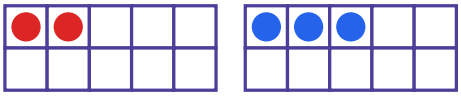

Task card 5 Doubles & Near Doubles

$5 + 5 = 10$. So $6 + 5 = ___$

Task card 6 Doubles & Near Doubles

Ben has 10 beads. Sam has 10 beads. How many beads do they have in all?

Task card 7 Doubles & Near Doubles

2 + 2 = 4. So 3 + 2 = ___

Task card 8 Doubles & Near Doubles

Sam has 10 cards. Ben has 9 cards. How many cards do they have in all?

Task card 9 Doubles & Near Doubles

8 + 8 = ___

Task card 10 Doubles & Near Doubles

5 + 4 = ___

Task card 11 Doubles & Near Doubles

4 + 3 = ___

Task card 12 Doubles & Near Doubles

3 + 4 = ___ Count the dots, or use a double.

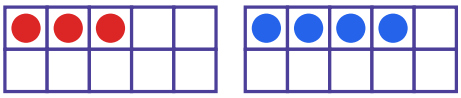

Task card 13 Doubles & Near Doubles

$10 + ___ = 20$

Task card 14 Doubles & Near Doubles

$5 + 5 = 10$. So

$5 + 6 = ___$

Task card 15 Doubles & Near Doubles

Ben has 10 shells. Lily has 9 shells. How many shells do they have in all?

Task card 16 Doubles & Near Doubles

___ + ___ = 16. Both numbers are the same. What is the number?

Task card 17 Doubles & Near Doubles

$10 + 10 = ___$

Task card 18 Doubles & Near Doubles

$2 + 3 = ___$

Task card 19 Doubles & Near Doubles

8 + 9 = ___ Count the dots, or use a double.

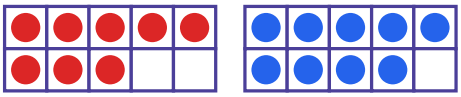

Task card 20 Doubles & Near Doubles

5 + ___ = 10

Task card 21 Doubles & Near Doubles

4 + 4 = 8. So 5 + 4 = ___

Task card 22 Doubles & Near Doubles

Mia has 10 cards. Ava has 9 cards. How many cards do they have in all?

Task card 23 Doubles & Near Doubles

___ + ___ = 12. Both numbers are the same. What is the number?

Task card 24 Doubles & Near Doubles

8 + 7 = ___ Think: 7 + 7, then add 1.

Doubles & Near Doubles Task Cards

Recording sheet · Grade 1 · Use doubles to help you add. The same facts come in different shapes!

Name: _____ Date: _____

Scan to check your answers

1	2	3	4
5	6	7	8
9	10	11	12
13	14	15	16
17	18	19	20
21	22	23	24

Doubles & Near Doubles Task Cards: Answer Key

Grade 1 · Medium

The answers online

1. 14	**2.** 9	**3.** 17
4. 5	**5.** 11	**6.** 20
7. 5	**8.** 19	**9.** 16
10. 9	**11.** 7	**12.** 7
13. 10	**14.** 11	**15.** 19
16. 8	**17.** 20	**18.** 5
19. 17	**20.** 5	**21.** 9
22. 19	**23.** 6	**24.** 15