Doubles & Near Doubles · 1

7 + 8 = ___

Doubles & Near Doubles · 2

10 + 9 = ___

Doubles & Near Doubles · 3

6 + 6 = ___

Doubles & Near Doubles · 4

9 + 8 = ___ Count the dots, or use a double.

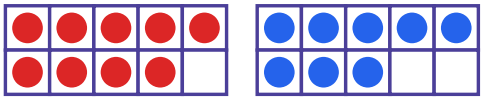

Doubles & Near Doubles · 5

2 + ___ = 4

Doubles & Near Doubles · 6

8 + ___ = 17

Doubles & Near Doubles · 7

Zoe has 9 blocks. Leo has 8 blocks. How many blocks do they have in all?

Doubles & Near Doubles · 8

___ + ___ = 14. Both numbers are the same. What is the number?

Doubles & Near Doubles · 2

ANSWER

19

Doubles & Near Doubles · 1

ANSWER

15

Doubles & Near Doubles · 4

ANSWER

17

Doubles & Near Doubles · 3

ANSWER

12

Doubles & Near Doubles · 6

ANSWER

9

Doubles & Near Doubles · 5

ANSWER

2

Doubles & Near Doubles · 8

ANSWER

7

Doubles & Near Doubles · 7

ANSWER

17

Doubles & Near Doubles · 9

3 + 2 = ___

Doubles & Near Doubles · 10

9 + 10 = ___

Doubles & Near Doubles · 11

8 + 8 = ___

Doubles & Near Doubles · 12

6 + 5 = ___ Count the dots, or use a double.

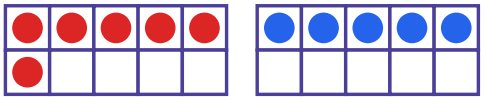

Doubles & Near Doubles · 13

5 + ___ = 10

Doubles & Near Doubles · 14

Leo has 3 buttons. Mia has 4 buttons. How many buttons do they have in all?

Doubles & Near Doubles · 15

7 + 6 = ___

Doubles & Near Doubles · 16

2 + 3 = ___

Doubles & Near Doubles · 10

ANSWER

19

Doubles & Near Doubles · 9

ANSWER

5

Doubles & Near Doubles · 12

ANSWER

11

Doubles & Near Doubles · 11

ANSWER

16

Doubles & Near Doubles · 14

ANSWER

7

Doubles & Near Doubles · 13

ANSWER

5

Doubles & Near Doubles · 16

ANSWER

5

Doubles & Near Doubles · 15

ANSWER

13

Doubles & Near Doubles · 17

9 + 9 = ___

Doubles & Near Doubles · 18

5 + 6 = ___ Count the dots, or use a double.

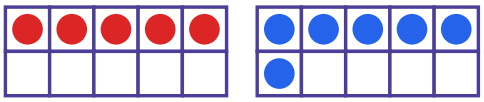

Doubles & Near Doubles · 19

7 + ___ = 14

Doubles & Near Doubles · 20

Sam has 9 marbles. Max has 8 marbles. How many marbles do they have in all?

Doubles & Near Doubles · 21

___ + ___ = 20. Both numbers are the same. What is the number?

Doubles & Near Doubles · 22

8 + 7 = ___

Doubles & Near Doubles · 23

3 + 3 = ___

Doubles & Near Doubles · 24

6 + 7 = ___ Count the dots, or use a double.

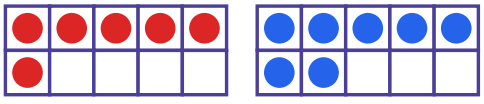

Doubles & Near Doubles · 18

ANSWER

11

Doubles & Near Doubles · 17

ANSWER

18

Doubles & Near Doubles · 20

ANSWER

17

Doubles & Near Doubles · 19

ANSWER

7

Doubles & Near Doubles · 22

ANSWER

15

Doubles & Near Doubles · 21

ANSWER

10

Doubles & Near Doubles · 24

ANSWER

13

Doubles & Near Doubles · 23

ANSWER

6