Doubles & Near Doubles · 1

7 + 7 = ___

Doubles & Near Doubles · 2

5 + 4 = ___ Think: 4 + 4, then add 1.

Doubles & Near Doubles · 3

8 + 9 = ___ Think: 8 + 8, then add 1.

Doubles & Near Doubles · 4

2 + 3 = ___ Count the dots, or use a double.

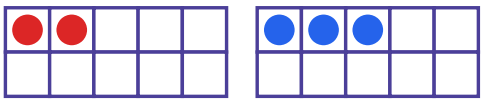

Doubles & Near Doubles · 5

5 + 5 = 10. So 6 + 5 = ___

Doubles & Near Doubles · 6

Ben has 10 beads. Sam has 10 beads. How many beads do they have in all?

Doubles & Near Doubles · 7

2 + 2 = 4. So 3 + 2 = ___

Doubles & Near Doubles · 8

Sam has 10 cards. Ben has 9 cards. How many cards do they have in all?

Doubles & Near Doubles · 2

ANSWER

9

Doubles & Near Doubles · 1

ANSWER

14

Doubles & Near Doubles · 4

ANSWER

5

Doubles & Near Doubles · 3

ANSWER

17

Doubles & Near Doubles · 6

ANSWER

20

Doubles & Near Doubles · 5

ANSWER

11

Doubles & Near Doubles · 8

ANSWER

19

Doubles & Near Doubles · 7

ANSWER

5

Doubles & Near Doubles · 9

8 + 8 = ___

Doubles & Near Doubles · 10

5 + 4 = ___

Doubles & Near Doubles · 11

4 + 3 = ___

Doubles & Near Doubles · 12

3 + 4 = ___ Count the dots, or use a double.

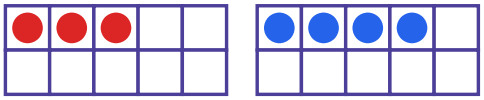

Doubles & Near Doubles · 13

10 + ___ = 20

Doubles & Near Doubles · 14

5 + 5 = 10. So 5 + 6 = ___

Doubles & Near Doubles · 15

Ben has 10 shells. Lily has 9 shells. How many shells do they have in all?

Doubles & Near Doubles · 16

___ + ___ = 16. Both numbers are the same. What is the number?

Doubles & Near Doubles · 10

ANSWER

9

Doubles & Near Doubles · 9

ANSWER

16

Doubles & Near Doubles · 12

ANSWER

7

Doubles & Near Doubles · 11

ANSWER

7

Doubles & Near Doubles · 14

ANSWER

11

Doubles & Near Doubles · 13

ANSWER

10

Doubles & Near Doubles · 16

ANSWER

8

Doubles & Near Doubles · 15

ANSWER

19

10 + 10 = ___

2 + 3 = ___

8 + 9 = ___ Count the dots, or use a double.

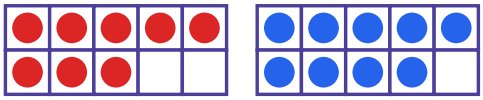

5 + ___ = 10

4 + 4 = 8. So 5 + 4 = ___

Mia has 10 cards. Ava has 9 cards. How many cards do they have in all?

___ + ___ = 12. Both numbers are the same. What is the number?

8 + 7 = ___ Think: 7 + 7, then add 1.

Doubles & Near Doubles · 18

ANSWER

5

Doubles & Near Doubles · 17

ANSWER

20

Doubles & Near Doubles · 20

ANSWER

5

Doubles & Near Doubles · 19

ANSWER

17

Doubles & Near Doubles · 22

ANSWER

19

Doubles & Near Doubles · 21

ANSWER

9

Doubles & Near Doubles · 24

ANSWER

15

Doubles & Near Doubles · 23

ANSWER

6