Doubles & Near Doubles · 1

8 + 8 = ___



Doubles & Near Doubles · 2

1 + 1 = ___



Doubles & Near Doubles · 3

5 + 5 = ___



Doubles & Near Doubles · 4

Count the dots. 3 + 3 = ___

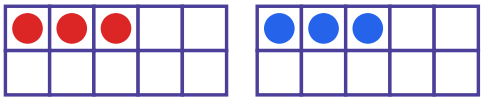

Doubles & Near Doubles · 5

Double 9 is ___

Doubles & Near Doubles · 6

Sam has 2 buttons. Ava has 2 buttons. How many buttons do they have in all?

Doubles & Near Doubles · 7

6 + 6 = ___

Doubles & Near Doubles · 8

___ + ___ = 8. Both numbers are the same. What is the number?

Doubles & Near Doubles · 2

ANSWER

2

Doubles & Near Doubles · 1

ANSWER

16

Doubles & Near Doubles · 4

ANSWER

6

Doubles & Near Doubles · 3

ANSWER

10

Doubles & Near Doubles · 6

ANSWER

4

Doubles & Near Doubles · 5

ANSWER

18

Doubles & Near Doubles · 8

ANSWER

4

Doubles & Near Doubles · 7

ANSWER

12

4 + 4 = ___



5 + 4 = ___



3 + 4 = ___ Count the dots, or use a double.

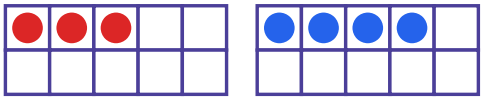

Double 2 is ___

Max has 4 cards. Lily has 4 cards. How many cards do they have in all?

5 + 5 = 10. So 5 + 6 = ___

3 + 3 = ___



7 + 8 = ___ Think: 7 + 7, then add 1.



Doubles & Near Doubles · 10

ANSWER

9

Doubles & Near Doubles · 9

ANSWER

8

Doubles & Near Doubles · 12

ANSWER

4

Doubles & Near Doubles · 11

ANSWER

7

Doubles & Near Doubles · 14

ANSWER

11

Doubles & Near Doubles · 13

ANSWER

8

Doubles & Near Doubles · 16

ANSWER

15

Doubles & Near Doubles · 15

ANSWER

6

3 + 2 = ___ Think: 2 + 2, then add 1.



4 + 3 = ___ Count the dots, or use a double.

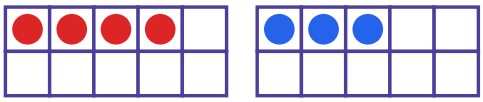

4 + 4 = 8. So 5 + 4 = ___

Sam has 9 beads. Zoe has 9 beads. How many beads do they have in all?

7 + 7 = 14. So 7 + 8 = ___

Mia has 9 marbles. Lily has 8 marbles. How many marbles do they have in all?

6 + 6 = ___



Count the dots. 10 + 10 = ___

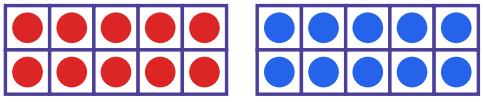

Doubles & Near Doubles · 18

ANSWER

7

Doubles & Near Doubles · 17

ANSWER

5

Doubles & Near Doubles · 20

ANSWER

18

Doubles & Near Doubles · 19

ANSWER

9

Doubles & Near Doubles · 22

ANSWER

17

Doubles & Near Doubles · 21

ANSWER

15

Doubles & Near Doubles · 24

ANSWER

20

Doubles & Near Doubles · 23

ANSWER

12