Data & Graphing · 1

There are 3 cats, 10 dogs, and 9 fish. How many are there in total (all three combined)?



Data & Graphing · 2

There are 6 soccer balls, 12 basketballs, and 3 tennis balls. Which has the most: soccer balls, basketballs, or tennis balls?



Data & Graphing · 3

There are 7 apples, 6 bananas, and 2 oranges. How many more apples are there than oranges?



Data & Graphing · 4

There are 13 apples, 5 bananas, and 6 oranges. How many are there in total (all three combined)?



Data & Graphing · 5

There are 3 apples, 7 bananas, and 6 oranges. Which has the most: apples, bananas, or oranges?



Data & Graphing · 6

There are 7 soccer balls, 2 basketballs, and 1 tennis ball. How many more soccer balls are there than tennis balls?



Data & Graphing · 7

There are 1 apple, 5 bananas, and 10 oranges. How many are there in total (all three combined)?



Data & Graphing · 8

There are 5 red cars, 7 blue cars, and 10 green cars. Which has the most: red cars, blue cars, or green cars?



Data & Graphing · 2

ANSWER

basketballs

Data & Graphing · 1

ANSWER

22

Data & Graphing · 4

ANSWER

24

Data & Graphing · 3

ANSWER

5

Data & Graphing · 6

ANSWER

6

Data & Graphing · 5

ANSWER

bananas

Data & Graphing · 8

ANSWER

green cars

Data & Graphing · 7

ANSWER

16

Data & Graphing · 9

There are 14 red cars, 3 blue cars, and 9 green cars. How many are there in total (all three combined)?



Data & Graphing · 10

There are 14 soccer balls, 4 basketballs, and 1 tennis ball. Which has the most: soccer balls, basketballs, or tennis balls?



Data & Graphing · 11

There are 8 apples, 1 banana, and 14 oranges. How many more oranges are there than bananas?



Data & Graphing · 12

There are 4 red cars, 2 blue cars, and 5 green cars. How many are there in total (all three combined)?



Data & Graphing · 13

There are 5 apples, 14 bananas, and 6 oranges. Which has the most: apples, bananas, or oranges?



Data & Graphing · 14

There are 5 cats, 8 dogs, and 10 fish. How many more fish are there than cats?



Data & Graphing · 15

There are 2 soccer balls, 13 basketballs, and 12 tennis balls. How many are there in total (all three combined)?



Data & Graphing · 16

There are 5 soccer balls, 1 basketball, and 4 tennis balls. Which has the most: soccer balls, basketballs, or tennis balls?



Data & Graphing · 10

ANSWER

soccer balls

Data & Graphing · 9

ANSWER

26

Data & Graphing · 12

ANSWER

11

Data & Graphing · 11

ANSWER

13

Data & Graphing · 14

ANSWER

5

Data & Graphing · 13

ANSWER

bananas

Data & Graphing · 16

ANSWER

soccer balls

Data & Graphing · 15

ANSWER

27

Data & Graphing · 17

There are 6 apples, 3 bananas, and 8 oranges. How many are there in total (all three combined)?



Data & Graphing · 18

There are 13 cats, 12 dogs, and 2 fish. Which has the most: cats, dogs, or fish?



Data & Graphing · 19

There are 7 apples, 1 banana, and 2 oranges. How many more apples are there than bananas?



Data & Graphing · 20

There are 9 apples, 1 banana, and 5 oranges. How many are there in total (all three combined)?



Data & Graphing · 21

There are 4 cats, 7 dogs, and 3 fish. Which has the most: cats, dogs, or fish?



Data & Graphing · 22

There are 8 soccer balls, 3 basketballs, and 12 tennis balls. How many more tennis balls are there than basketballs?



Data & Graphing · 23

There are 10 apples, 2 bananas, and 3 oranges. How many are there in total (all three combined)?



Data & Graphing · 24

There are 12 apples, 4 bananas, and 3 oranges. Which has the most: apples, bananas, or oranges?



Data & Graphing · 18

ANSWER

cats

Data & Graphing · 17

ANSWER

17

Data & Graphing · 20

ANSWER

15

Data & Graphing · 19

ANSWER

6

Data & Graphing · 22

ANSWER

9

Data & Graphing · 21

ANSWER

dogs

Data & Graphing · 24

ANSWER

apples

Data & Graphing · 23

ANSWER

15