Data & Graphing · 1

There are 7 cats, 2 dogs, and 5 fish. How many are there in total (all three combined)?



Data & Graphing · 2

There are 1 red car, 6 blue cars, and 5 green cars. Which has the most: red cars, blue cars, or green cars?



Data & Graphing · 3

There are 5 red cars, 2 blue cars, and 1 green car. How many more red cars are there than green cars?



Data & Graphing · 4

There are 3 apples, 4 bananas, and 8 oranges. How many are there in total (all three combined)?



Data & Graphing · 5

There are 1 red car, 9 blue cars, and 5 green cars. Which has the most: red cars, blue cars, or green cars?



Data & Graphing · 6

There are 3 red cars, 2 blue cars, and 10 green cars. How many more green cars are there than blue cars?



Data & Graphing · 7

There are 5 soccer balls, 3 basketballs, and 1 tennis ball. How many are there in total (all three combined)?



Data & Graphing · 8

There are 10 red cars, 4 blue cars, and 9 green cars. Which has the most: red cars, blue cars, or green cars?



Data & Graphing · 2

ANSWER

blue cars

Data & Graphing · 1

ANSWER

14

Data & Graphing · 4

ANSWER

15

Data & Graphing · 3

ANSWER

4

Data & Graphing · 6

ANSWER

8

Data & Graphing · 5

ANSWER

blue cars

Data & Graphing · 8

ANSWER

red cars

Data & Graphing · 7

ANSWER

9

Data & Graphing · 9

There are 10 apples, 8 bananas, and 7 oranges. How many are there in total (all three combined)?



Data & Graphing · 10

There are 3 cats, 1 dog, and 2 fish. Which has the most: cats, dogs, or fish?



Data & Graphing · 11

There are 8 red cars, 5 blue cars, and 9 green cars. How many more green cars are there than blue cars?



Data & Graphing · 12

There are 3 apples, 1 banana, and 4 oranges. How many are there in total (all three combined)?



Data & Graphing · 13

There are 1 apple, 6 bananas, and 5 oranges. Which has the most: apples, bananas, or oranges?



Data & Graphing · 14

There are 5 cats, 4 dogs, and 6 fish. How many more fish are there than dogs?



Data & Graphing · 15

There are 2 apples, 6 bananas, and 5 oranges. How many are there in total (all three combined)?



Data & Graphing · 16

There are 9 cats, 7 dogs, and 1 fish. Which has the most: cats, dogs, or fish?



Data & Graphing · 10

ANSWER

cats

Data & Graphing · 9

ANSWER

25

Data & Graphing · 12

ANSWER

8

Data & Graphing · 11

ANSWER

4

Data & Graphing · 14

ANSWER

2

Data & Graphing · 13

ANSWER

bananas

Data & Graphing · 16

ANSWER

cats

Data & Graphing · 15

ANSWER

13

Data & Graphing · 17

There are 1 red car, 4 blue cars, and 9 green cars. How many are there in total (all three combined)?



Data & Graphing · 18

There are 8 red cars, 10 blue cars, and 3 green cars. Which has the most: red cars, blue cars, or green cars?



Data & Graphing · 19

There are 1 cat, 11 dogs, and 5 fish. How many more dogs are there than cats?



Data & Graphing · 20

There are 4 apples, 2 bananas, and 5 oranges. How many are there in total (all three combined)?



Data & Graphing · 21

There are 8 soccer balls, 9 basketballs, and 4 tennis balls. Which has the most: soccer balls, basketballs, or tennis balls?



Data & Graphing · 22

There are 7 apples, 10 bananas, and 4 oranges. How many more bananas are there than oranges?



Data & Graphing · 23

There are 9 soccer balls, 7 basketballs, and 12 tennis balls. How many are there in total (all three combined)?



Data & Graphing · 24

There are 6 apples, 10 bananas, and 7 oranges. Which has the most: apples, bananas, or oranges?



Data & Graphing · 18

ANSWER

blue cars

Data & Graphing · 17

ANSWER

14

Data & Graphing · 20

ANSWER

11

Data & Graphing · 19

ANSWER

10

Data & Graphing · 22

ANSWER

6

Data & Graphing · 21

ANSWER

basketballs

Data & Graphing · 24

ANSWER

bananas

Data & Graphing · 23

ANSWER

28