Data & Graphing · 1

There are 4 apples, 2 bananas, and 7 oranges. How many are there in total (all three combined)?



Data & Graphing · 2

There are 7 apples, 4 bananas, and 6 oranges. Which has the most: apples, bananas, or oranges?



Data & Graphing · 3

There are 6 cats, 3 dogs, and 4 fish. How many more cats are there than dogs?



Data & Graphing · 4

There are 5 red cars, 6 blue cars, and 3 green cars. How many are there in total (all three combined)?



Data & Graphing · 5

There are 1 red car, 6 blue cars, and 3 green cars. Which has the most: red cars, blue cars, or green cars?



Data & Graphing · 6

There are 6 apples, 4 bananas, and 3 oranges. How many more apples are there than oranges?



Data & Graphing · 7

There are 1 apple, 5 bananas, and 2 oranges. How many are there in total (all three combined)?



Data & Graphing · 8

There are 5 soccer balls, 1 basketball, and 6 tennis balls. Which has the most: soccer balls, basketballs, or tennis balls?



Data & Graphing · 2

ANSWER

apples

Data & Graphing · 1

ANSWER

13

Data & Graphing · 4

ANSWER

14

Data & Graphing · 3

ANSWER

3

Data & Graphing · 6

ANSWER

3

Data & Graphing · 5

ANSWER

blue cars

Data & Graphing · 8

ANSWER

tennis balls

Data & Graphing · 7

ANSWER

8

Data & Graphing · 9

There are 4 red cars, 6 blue cars, and 7 green cars. How many are there in total (all three combined)?



Data & Graphing · 10

There are 7 soccer balls, 2 basketballs, and 8 tennis balls. Which has the most: soccer balls, basketballs, or tennis balls?



Data & Graphing · 11

There are 4 red cars, 6 blue cars, and 7 green cars. How many more green cars are there than red cars?



Data & Graphing · 12

There are 5 cats, 1 dog, and 7 fish. How many are there in total (all three combined)?



Data & Graphing · 13

There are 1 cat, 6 dogs, and 5 fish. Which has the most: cats, dogs, or fish?



Data & Graphing · 14

There are 8 apples, 5 bananas, and 2 oranges. How many more apples are there than oranges?



Data & Graphing · 15

There are 7 cats, 5 dogs, and 6 fish. How many are there in total (all three combined)?



Data & Graphing · 16

There are 7 apples, 5 bananas, and 8 oranges. Which has the most: apples, bananas, or oranges?



Data & Graphing · 10

ANSWER

tennis balls

Data & Graphing · 9

ANSWER

17

Data & Graphing · 12

ANSWER

13

Data & Graphing · 11

ANSWER

3

Data & Graphing · 14

ANSWER

6

Data & Graphing · 13

ANSWER

dogs

Data & Graphing · 16

ANSWER

oranges

Data & Graphing · 15

ANSWER

18

Data & Graphing · 17

There are 1 red car, 7 blue cars, and 9 green cars. How many are there in total (all three combined)?



Data & Graphing · 18

There are 7 soccer balls, 5 basketballs, and 3 tennis balls. Which has the most: soccer balls, basketballs, or tennis balls?



Data & Graphing · 19

There are 7 apples, 6 bananas, and 1 orange. How many more apples are there than oranges?



Data & Graphing · 20

There are 4 soccer balls, 5 basketballs, and 8 tennis balls. How many are there in total (all three combined)?



Data & Graphing · 21

There are 9 soccer balls, 7 basketballs, and 2 tennis balls. Which has the most: soccer balls, basketballs, or tennis balls?



Data & Graphing · 22

There are 4 apples, 7 bananas, and 6 oranges. How many more bananas are there than apples?



Data & Graphing · 23

There are 9 soccer balls, 1 basketball, and 6 tennis balls. How many are there in total (all three combined)?



Data & Graphing · 24

There are 6 cats, 9 dogs, and 3 fish. Which has the most: cats, dogs, or fish?



Data & Graphing · 18

ANSWER

soccer balls

Data & Graphing · 17

ANSWER

17

Data & Graphing · 20

ANSWER

17

Data & Graphing · 19

ANSWER

6

Data & Graphing · 22

ANSWER

3

Data & Graphing · 21

ANSWER

soccer balls

Data & Graphing · 24

ANSWER

dogs

Data & Graphing · 23

ANSWER

16