Counting with Questions · 1

There are 6 balloons. 5 balloons are popped. How many are left?



Counting with Questions · 2

There are 5 balloons. 3 balloons are popped. How many are left?



Counting with Questions · 3

There are 13 apples. 10 apples are eaten. How many are left?



Counting with Questions · 4

There are 4 apples. 2 apples are eaten. How many are left?



Counting with Questions · 5

There are 13 hearts. 10 hearts are colored in. How many are left?



Counting with Questions · 6

There are 8 stars. 3 stars are given away. How many are left?



Counting with Questions · 7

There are 3 hearts. 1 heart is colored in. How many are left?



Counting with Questions · 8

There are 7 hearts. 4 hearts are colored in. How many are left?



Counting with Questions · 2

ANSWER

2

Counting with Questions · 1

ANSWER

1

Counting with Questions · 4

ANSWER

2

Counting with Questions · 3

ANSWER

3

Counting with Questions · 6

ANSWER

5

Counting with Questions · 5

ANSWER

3

Counting with Questions · 8

ANSWER

3

Counting with Questions · 7

ANSWER

2

There are 6 hearts. 4 hearts are colored in. How many are left?



There are 2 balloons. 1 balloon is popped. How many are left?



There are 14 apples. 4 apples are eaten. How many are left?



There are 13 balloons. 8 balloons are popped. How many are left?



There are 6 apples. 4 apples are eaten. How many are left?



There are 7 hearts. 5 hearts are colored in. How many are left?



There are 6 apples. 5 apples are eaten. How many are left?



There are 14 apples. 9 apples are eaten. How many are left?



Counting with Questions · 10

ANSWER

1

Counting with Questions · 9

ANSWER

2

Counting with Questions · 12

ANSWER

5

Counting with Questions · 11

ANSWER

10

Counting with Questions · 14

ANSWER

2

Counting with Questions · 13

ANSWER

2

Counting with Questions · 16

ANSWER

5

Counting with Questions · 15

ANSWER

1

Counting with Questions · 17

There are 7 apples. 1 apple is eaten. How many are left?



Counting with Questions · 18

There are 11 stars. 8 stars are given away. How many are left?



Counting with Questions · 19

There are 12 apples. 4 apples are eaten. How many are left?



Counting with Questions · 20

There are 13 apples. 8 apples are eaten. How many are left?



Counting with Questions · 21

There are 9 stars. 8 stars are given away. How many are left?



Counting with Questions · 22

There are 8 hearts. 1 heart is colored in. How many are left?



Counting with Questions · 23

There are 10 stars. 5 stars are given away. How many are left?



Counting with Questions · 24

There are 4 hearts. 1 heart is colored in. How many are left?



Counting with Questions · 18

ANSWER

3

Counting with Questions · 17

ANSWER

6

Counting with Questions · 20

ANSWER

5

Counting with Questions · 19

ANSWER

8

Counting with Questions · 22

ANSWER

7

Counting with Questions · 21

ANSWER

1

Counting with Questions · 24

ANSWER

3

Counting with Questions · 23

ANSWER

5