Count and Combine · 1

How many are there in all?

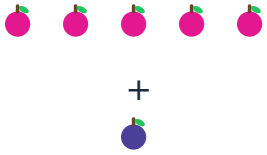

Count and Combine · 2

How many are there in all?



Count and Combine · 3

3 + 5 = ___



Count and Combine · 4

How many dots are there in all?

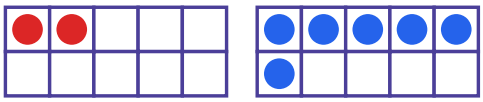

Count and Combine · 5

The two parts make the whole. What is the missing number?

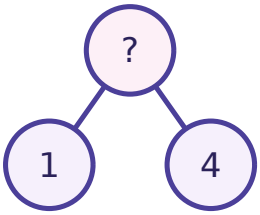

Count and Combine · 6

Ben has 2 crayons and gets 3 more. How many crayons does Ben have now?

Count and Combine · 7

3 + 1 = ___

Count and Combine · 8

There are 5 stars in all. How many are hiding in the box?



Count and Combine · 2

ANSWER

6

Count and Combine · 1

ANSWER

6

Count and Combine · 4

ANSWER

8

Count and Combine · 3

ANSWER

8

Count and Combine · 6

ANSWER

5

Count and Combine · 5

ANSWER

5

Count and Combine · 8

ANSWER

3

Count and Combine · 7

ANSWER

4

Count and Combine · 9

How many are there in all?

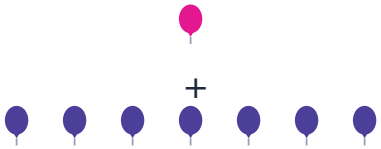

Count and Combine · 10

How many are there in all?



Count and Combine · 11

5 + 7 = ___

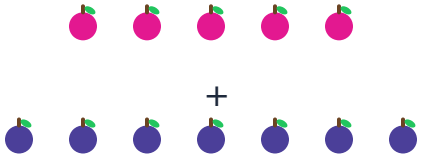

Count and Combine · 12

How many dots are there in all?

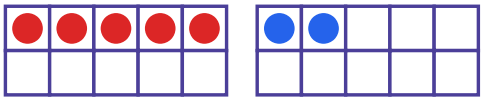

Count and Combine · 13

The two parts make the whole. What is the missing number?

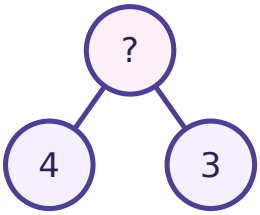

Count and Combine · 14

Zoe has 5 shells and gets 6 more. How many shells does Zoe have now?

Count and Combine · 15

4 + 6 = ___

Count and Combine · 16

There are 11 balloons in all. How many are hiding in the box?

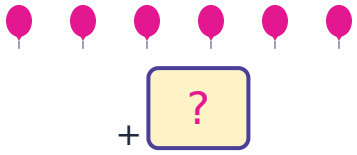

Count and Combine · 10

ANSWER

10

Count and Combine · 9

ANSWER

8

Count and Combine · 12

ANSWER

7

Count and Combine · 11

ANSWER

12

Count and Combine · 14

ANSWER

11

Count and Combine · 13

ANSWER

7

Count and Combine · 16

ANSWER

5

Count and Combine · 15

ANSWER

10

Count and Combine · 17

How many are there in all?



Count and Combine · 18

How many are there in all?



Count and Combine · 19

5 + 8 = ___



Count and Combine · 20

How many dots are there in all?

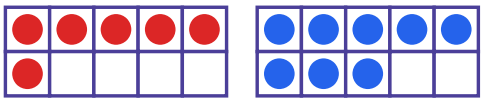

Count and Combine · 21

The two parts make the whole. What is the missing number?

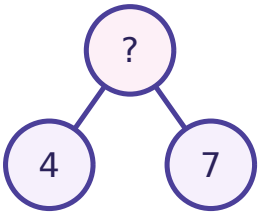

Count and Combine · 22

Ava has 2 stickers and gets 3 more. How many stickers does Ava have now?

Count and Combine · 23

3 + 2 = ___

Count and Combine · 24

There are 11 stars in all. How many are hiding in the box?



Count and Combine · 18

ANSWER

7

Count and Combine · 17

ANSWER

11

Count and Combine · 20

ANSWER

14

Count and Combine · 19

ANSWER

13

Count and Combine · 22

ANSWER

5

Count and Combine · 21

ANSWER

11

Count and Combine · 24

ANSWER

7

Count and Combine · 23

ANSWER

5