Count and Combine · 1

How many are there in all?



Count and Combine · 2

How many are there in all?



Count and Combine · 3

9 + 6 = ___

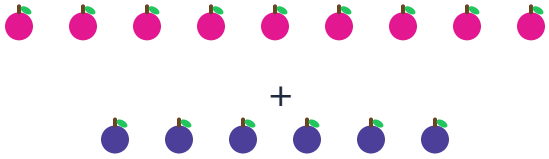

Count and Combine · 4

How many dots are there in all?

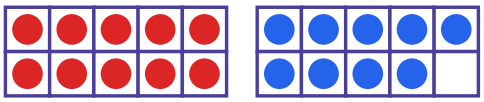

Count and Combine · 5

The two parts make the whole. What is the missing number?

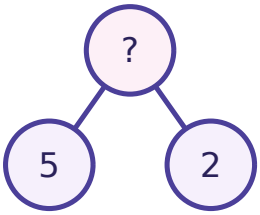

Count and Combine · 6

Ben has 2 shells and gets 6 more. How many shells does Ben have now?

Count and Combine · 7

5 + 3 = ___

Count and Combine · 8

There are 12 hearts in all. How many are hiding in the box?



Count and Combine · 2

ANSWER

14

Count and Combine · 1

ANSWER

16

Count and Combine · 4

ANSWER

19

Count and Combine · 3

ANSWER

15

Count and Combine · 6

ANSWER

8

Count and Combine · 5

ANSWER

7

Count and Combine · 8

ANSWER

7

Count and Combine · 7

ANSWER

8

Count and Combine · 9

How many are there in all?

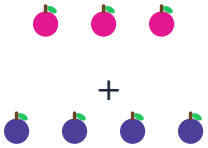

Count and Combine · 10

How many are there in all?

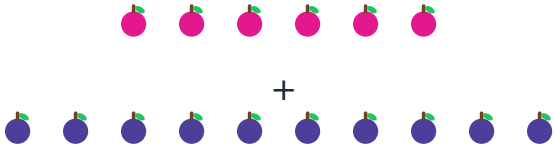

Count and Combine · 11

7 + 3 = ___



Count and Combine · 12

How many dots are there in all?

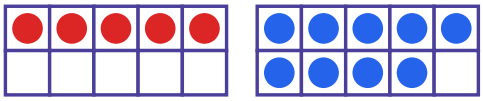

Count and Combine · 13

The two parts make the whole. What is the missing number?

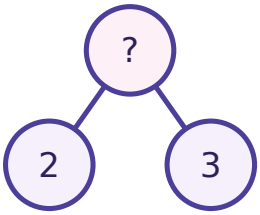

Count and Combine · 14

Mia has 10 marbles and gets 7 more. How many marbles does Mia have now?

Count and Combine · 15

2 + 10 = ___

Count and Combine · 16

There are 12 hearts in all. How many are hiding in the box?



Count and Combine · 10

ANSWER

16

Count and Combine · 9

ANSWER

7

Count and Combine · 12

ANSWER

14

Count and Combine · 11

ANSWER

10

Count and Combine · 14

ANSWER

17

Count and Combine · 13

ANSWER

5

Count and Combine · 16

ANSWER

4

Count and Combine · 15

ANSWER

12

Count and Combine · 17

How many are there in all?



Count and Combine · 18

How many are there in all?



Count and Combine · 19

$4 + 1 = ___$



Count and Combine · 20

How many dots are there in all?

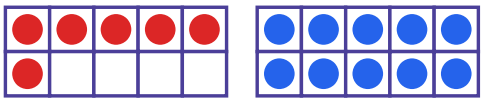

Count and Combine · 21

The two parts make the whole. What is the missing number?

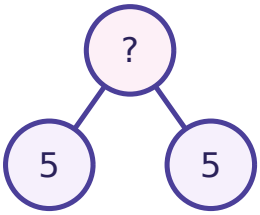

Count and Combine · 22

Zoe has 9 toy cars and gets 7 more. How many toy cars does Zoe have now?

Count and Combine · 23

$8 + 7 = ___$

Count and Combine · 24

There are 16 apples in all. How many are hiding in the box?

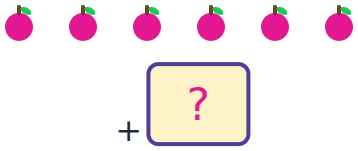

Count and Combine · 18

ANSWER

13

Count and Combine · 17

ANSWER

8

Count and Combine · 20

ANSWER

16

Count and Combine · 19

ANSWER

5

Count and Combine · 22

ANSWER

16

Count and Combine · 21

ANSWER

10

Count and Combine · 24

ANSWER

10

Count and Combine · 23

ANSWER

15