Count and Combine · 1

How many are there in all?



Count and Combine · 2

How many are there in all?



Count and Combine · 3

1 + 1 = ___



Count and Combine · 4

How many dots are there in all?

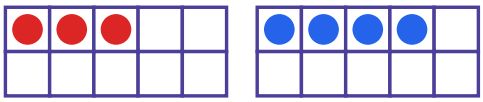

Count and Combine · 5

The two parts make the whole. What is the missing number?

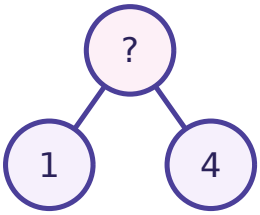

Count and Combine · 6

Lily has 2 cards and gets 1 more. How many cards does Lily have now?

Count and Combine · 7

3 + 3 = ___

Count and Combine · 8

There are 5 hearts in all. How many are hiding in the box?



Count and Combine · 2

ANSWER

4

Count and Combine · 1

ANSWER

7

Count and Combine · 4

ANSWER

7

Count and Combine · 3

ANSWER

2

Count and Combine · 6

ANSWER

3

Count and Combine · 5

ANSWER

5

Count and Combine · 8

ANSWER

1

Count and Combine · 7

ANSWER

6

Count and Combine · 9

How many are there in all?



Count and Combine · 10

How many are there in all?



Count and Combine · 11

1 + 2 = ___



Count and Combine · 12

How many dots are there in all?

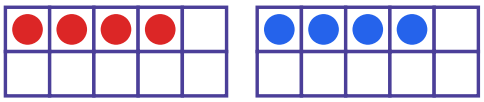

Count and Combine · 13

The two parts make the whole. What is the missing number?

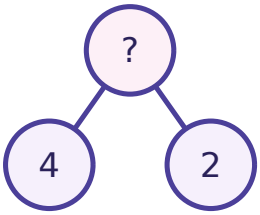

Count and Combine · 14

Mia has 5 toy cars and gets 5 more. How many toy cars does Mia have now?

Count and Combine · 15

1 + 5 = ___

Count and Combine · 16

There are 7 hearts in all. How many are hiding in the box?



Count and Combine · 10

ANSWER

5

Count and Combine · 9

ANSWER

5

Count and Combine · 12

ANSWER

8

Count and Combine · 11

ANSWER

3

Count and Combine · 14

ANSWER

10

Count and Combine · 13

ANSWER

6

Count and Combine · 16

ANSWER

2

Count and Combine · 15

ANSWER

6

Count and Combine · 17

How many are there in all?



Count and Combine · 18

$6 + 4 = ___$



Count and Combine · 19

How many dots are there in all?

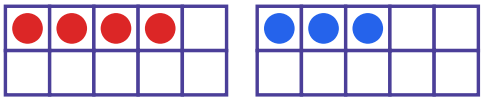

Count and Combine · 20

The two parts make the whole. What is the missing number?

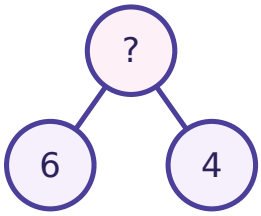

Count and Combine · 21

Zoe has 3 stickers and gets 4 more. How many stickers does Zoe have now?

Count and Combine · 22

$2 + 4 = ___$

Count and Combine · 23

There are 11 stars in all. How many are hiding in the box?



Count and Combine · 24

How many are there in all?



Count and Combine · 18

ANSWER

10

Count and Combine · 17

ANSWER

10

Count and Combine · 20

ANSWER

10

Count and Combine · 19

ANSWER

7

Count and Combine · 22

ANSWER

6

Count and Combine · 21

ANSWER

7

Count and Combine · 24

ANSWER

2

Count and Combine · 23

ANSWER

6