Comparison Word Problems: How Many More or Fewer? · 1

Lily has 4 cookies. Sam has 1 cookie. How many more cookies does Lily have than Sam?



Comparison Word Problems: How Many More or Fewer? · 2

Zoe has 6 cookies. Sam has 7 cookies. How many fewer cookies does Zoe have than Sam?



Comparison Word Problems: How Many More or Fewer? · 3

Noah has 4 balloons. Zoe has 2 balloons. How many more balloons does Noah have than Zoe?



Comparison Word Problems: How Many More or Fewer? · 4

Lily has 2 apples. Ben has 8 apples. How many fewer apples does Lily have than Ben?



Comparison Word Problems: How Many More or Fewer? · 5

Sam has 1 sticker. Ben has 5 stickers. How many more stickers does Ben have than Sam?



Comparison Word Problems: How Many More or Fewer? · 6

Noah has 6 cookies. Lily has 8 cookies. How many fewer cookies does Noah have than Lily?



Comparison Word Problems: How Many More or Fewer? · 7

Noah has 3 apples. Ava has 4 apples. How many more apples does Ava have than Noah?



Comparison Word Problems: How Many More or Fewer? · 8

Leo has 4 cookies. Lily has 7 cookies. How many fewer cookies does Leo have than Lily?



Comparison Word Problems: How Many More or Fewer? · 2

ANSWER

1

Comparison Word Problems: How Many More or Fewer? · 1

ANSWER

3

Comparison Word Problems: How Many More or Fewer? · 4

ANSWER

6

Comparison Word Problems: How Many More or Fewer? · 3

ANSWER

2

Comparison Word Problems: How Many More or Fewer? · 6

ANSWER

2

Comparison Word Problems: How Many More or Fewer? · 5

ANSWER

4

Comparison Word Problems: How Many More or Fewer? · 8

ANSWER

3

Comparison Word Problems: How Many More or Fewer? · 7

ANSWER

1

Comparison Word Problems: How Many More or Fewer? · 9

Noah has 8 apples. Lily has 1 apple. How many more apples does Noah have than Lily?



Comparison Word Problems: How Many More or Fewer? · 10

Ava has 3 stickers. Mia has 6 stickers. How many fewer stickers does Ava have than Mia?



Comparison Word Problems: How Many More or Fewer? · 11

Mia has 2 apples. Sam has 6 apples. How many more apples does Sam have than Mia?



Comparison Word Problems: How Many More or Fewer? · 12

Sam has 2 stickers. Leo has 5 stickers. How many fewer stickers does Sam have than Leo?



Comparison Word Problems: How Many More or Fewer? · 13

Sam has 10 balloons. Zoe has 8 balloons. How many more balloons does Sam have than Zoe?



Comparison Word Problems: How Many More or Fewer? · 14

Ben has 8 cookies. Mia has 9 cookies. How many fewer cookies does Ben have than Mia?



Comparison Word Problems: How Many More or Fewer? · 15

Lily has 5 cookies. Leo has 1 cookie. How many more cookies does Lily have than Leo?



Comparison Word Problems: How Many More or Fewer? · 16

Noah has 7 apples. Ben has 1 apple. How many fewer apples does Ben have than Noah?



Comparison Word Problems: How Many More or Fewer? · 10

ANSWER

3

Comparison Word Problems: How Many More or Fewer? · 9

ANSWER

7

Comparison Word Problems: How Many More or Fewer? · 12

ANSWER

3

Comparison Word Problems: How Many More or Fewer? · 11

ANSWER

4

Comparison Word Problems: How Many More or Fewer? · 14

ANSWER

1

Comparison Word Problems: How Many More or Fewer? · 13

ANSWER

2

Comparison Word Problems: How Many More or Fewer? · 16

ANSWER

6

Comparison Word Problems: How Many More or Fewer? · 15

ANSWER

4

Lily has 9 apples. Noah has 4 apples. How many more apples does Lily have than Noah?



Ava has 10 balloons. Zoe has 5 balloons. How many fewer balloons does Zoe have than Ava?



Sam has 6 balloons. Ava has 2 more balloons than Sam. How many balloons does Ava have?

Mia has 10 cookies. Zoe has 2 fewer cookies than Mia. How many cookies does Zoe have?

Sam has 6 apples. Mia has 9 apples. How many more apples does Mia have than Sam?



Ava has 7 marbles. Lily has 1 marble. How many fewer marbles does Lily have than Ava?



Noah has 2 apples. Zoe has 9 more apples than Noah. How many apples does Zoe have?

Noah has 11 balloons. Leo has 10 fewer balloons than Noah. How many balloons does Leo have?

Comparison Word Problems: How Many More or Fewer? · 18

ANSWER

5

Comparison Word Problems: How Many More or Fewer? · 17

ANSWER

5

Comparison Word Problems: How Many More or Fewer? · 20

ANSWER

8

Comparison Word Problems: How Many More or Fewer? · 19

ANSWER

8

Comparison Word Problems: How Many More or Fewer? · 22

ANSWER

6

Comparison Word Problems: How Many More or Fewer? · 21

ANSWER

3

Comparison Word Problems: How Many More or Fewer? · 24

ANSWER

1

Comparison Word Problems: How Many More or Fewer? · 23

ANSWER

11