Task card 1 Comparing & Ordering Lengths

Which ribbon is the longest?
Write A, B, or C.



Task card 2 Comparing & Ordering Lengths

How many cubes long is ribbon C?

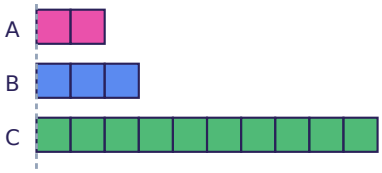

Task card 3 Comparing & Ordering Lengths

How many cubes long is ribbon B?

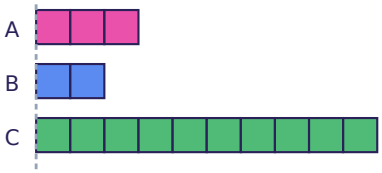

Task card 4 Comparing & Ordering Lengths

Which ribbon is the longest?
Write A, B, or C.



Task card 5 Comparing & Ordering Lengths

Which ribbon is the longest?
Write A, B, or C.



Task card 6 Comparing & Ordering Lengths

Which ribbon is the longest?
Write A, B, or C.



Task card 7 Comparing & Ordering Lengths

Which ribbon is the shortest?
Write A, B, or C.



Task card 8 Comparing & Ordering Lengths

How many cubes long is ribbon C?

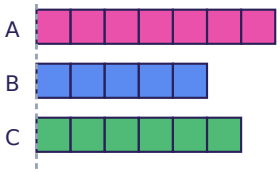

Task card 9 Comparing & Ordering Lengths

Which ribbon is the longest?
Write A, B, or C.



Task card 10 Comparing & Ordering Lengths

How many cubes longer is ribbon B than ribbon C?

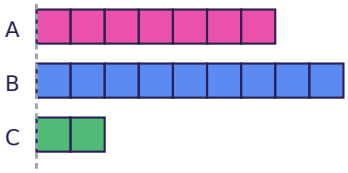

Task card 11 Comparing & Ordering Lengths

How many cubes longer is ribbon B than ribbon A?

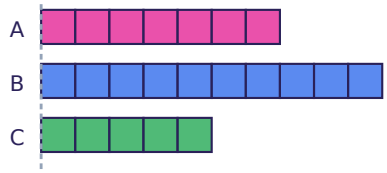

Task card 12 Comparing & Ordering Lengths

How many cubes longer is ribbon C than ribbon B?

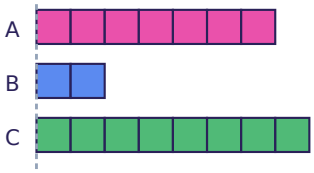

Task card 13 Comparing & Ordering Lengths

How many cubes long is ribbon C?

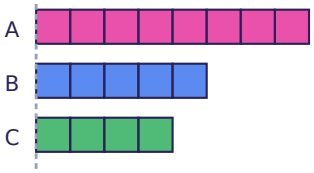

Task card 14 Comparing & Ordering Lengths

Lily's ribbon is shorter than Sam's. Sam's ribbon is shorter than Max's. Whose ribbon is the shortest? Write Lily, Max, or Sam.

Task card 15 Comparing & Ordering Lengths

How many cubes longer is ribbon C than ribbon A?

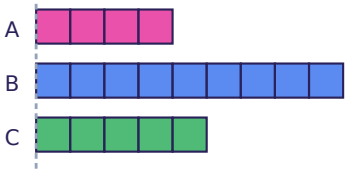

Task card 16 Comparing & Ordering Lengths

How many cubes long is ribbon B?

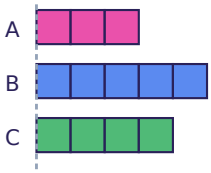

Task card 17 Comparing & Ordering Lengths

Leo's ribbon is shorter than Zoe's. Zoe's ribbon is shorter than Sam's. Whose ribbon is the longest? Write Leo, Sam, or Zoe.

Task card 18 Comparing & Ordering Lengths

Which ribbon is the longest? Write A, B, or C.

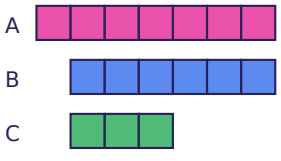

Task card 19 Comparing & Ordering Lengths

Lily's ribbon is shorter than Mia's. Mia's ribbon is shorter than Ben's. Whose ribbon is the shortest? Write Ben, Lily, or Mia.

Task card 20 Comparing & Ordering Lengths

Mia's ribbon is shorter than Zoe's. Zoe's ribbon is shorter than Nora's. Whose ribbon is the shortest? Write Mia, Nora, or Zoe.

Task card 21 Comparing & Ordering Lengths

How many cubes long is ribbon B?

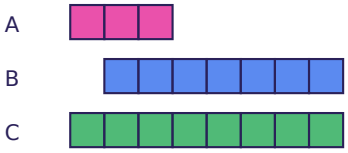

Task card 22 Comparing & Ordering Lengths

Which ribbon is the longest? Write A, B, or C.

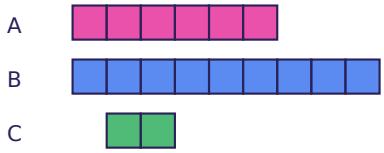

Task card 23 Comparing & Ordering Lengths

Which ribbon is the longest? Write A, B, or C.

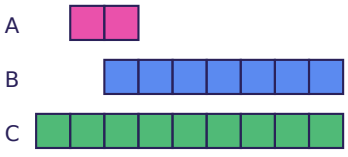

Task card 24 Comparing & Ordering Lengths

How many cubes long is ribbon B?

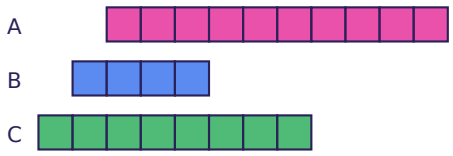

Comparing & Ordering Lengths Task Cards

Recording sheet · Grade 1 · Look at the ribbons (or read the clues) and answer the question.

Name: _____ Date: _____

Scan to check your answers

1	2	3	4
5	6	7	8
9	10	11	12
13	14	15	16
17	18	19	20
21	22	23	24

Comparing & Ordering Lengths Task Cards: Answer Key

Grade 1 · Medium

The answers online

1. A	**2.** 10	**3.** 2
4. B	**5.** B	**6.** B
7. B	**8.** 6	**9.** C
10. 7	**11.** 3	**12.** 6
13. 4	**14.** Lily	**15.** 1
16. 5	**17.** Sam	**18.** A
19. Lily	**20.** Mia	**21.** 7
22. B	**23.** C	**24.** 4