Task card 1 Comparing & Ordering Lengths

How many cubes longer is ribbon A than ribbon C?

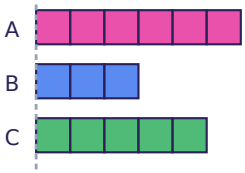

Task card 2 Comparing & Ordering Lengths

How many cubes longer is ribbon B than ribbon A?

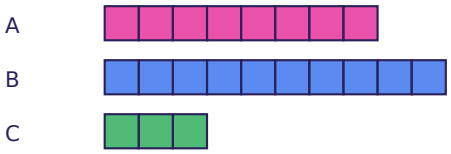

Task card 3 Comparing & Ordering Lengths

Max's ribbon is longer than Ava's. Ava's ribbon is longer than Leo's. Whose ribbon is the shortest? Write Ava, Leo, or Max.

Task card 4 Comparing & Ordering Lengths

Zoe's ribbon is shorter than Mia's. Mia's ribbon is shorter than Sam's. Whose ribbon is the shortest? Write Mia, Sam, or Zoe.

Task card 5 Comparing & Ordering Lengths

Which ribbon is the shortest? Write A, B, or C.

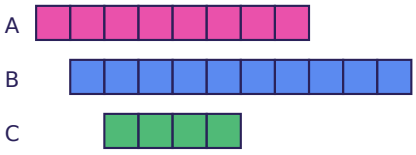

Task card 6 Comparing & Ordering Lengths

Max's ribbon is longer than Sam's. Sam's ribbon is longer than Lily's. Whose ribbon is the shortest? Write Lily, Max, or Sam.

Task card 7 Comparing & Ordering Lengths

Which ribbon is the shortest? Write A, B, or C.

A



B



C



Task card 8 Comparing & Ordering Lengths

How many cubes long is ribbon A?

A



B



C



Task card 9 Comparing & Ordering Lengths

Which ribbon is the shortest? Write A, B, or C.

A



B



C



Task card 10 Comparing & Ordering Lengths

Ben's ribbon is longer than Sam's. Sam's ribbon is longer than Mia's. Whose ribbon is the shortest? Write Ben, Mia, or Sam.

Task card 11 Comparing & Ordering Lengths

How many cubes long is ribbon B?

A



B



C



Task card 12 Comparing & Ordering Lengths

How many cubes longer is ribbon B than ribbon A?

A



B



C



Task card 13 Comparing & Ordering Lengths

How many cubes longer is ribbon A than ribbon B?

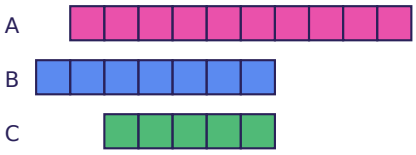

Task card 14 Comparing & Ordering Lengths

How many cubes long is ribbon B?

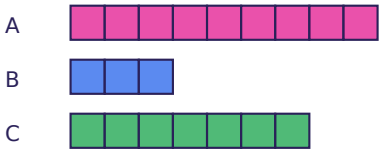

Task card 15 Comparing & Ordering Lengths

Mia's ribbon is shorter than Ava's. Ava's ribbon is shorter than Nora's. Whose ribbon is the longest? Write Ava, Mia, or Nora.

Task card 16 Comparing & Ordering Lengths

How many cubes longer is ribbon B than ribbon C?

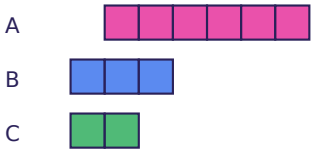

Task card 17 Comparing & Ordering Lengths

How many cubes longer is ribbon A than ribbon B?

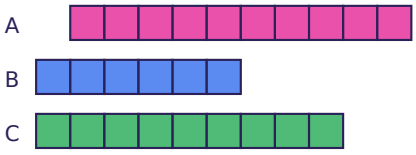

Task card 18 Comparing & Ordering Lengths

Ava's ribbon is longer than Lily's. Lily's ribbon is longer than Max's. Whose ribbon is the shortest? Write Ava, Lily, or Max.

Task card 19 Comparing & Ordering Lengths

How many cubes longer is ribbon B than ribbon A?

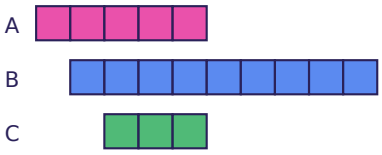

Task card 20 Comparing & Ordering Lengths

How many cubes longer is ribbon C than ribbon A?

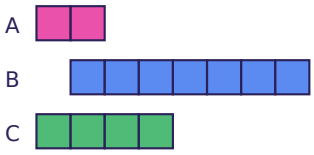

Task card 21 Comparing & Ordering Lengths

Ben's ribbon is shorter than Nora's. Nora's ribbon is shorter than Mia's. Whose ribbon is the shortest? Write Ben, Mia, or Nora.

Task card 22 Comparing & Ordering Lengths

How many cubes longer is ribbon A than ribbon B?

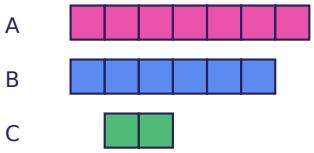

Task card 23 Comparing & Ordering Lengths

How many cubes longer is ribbon B than ribbon C?

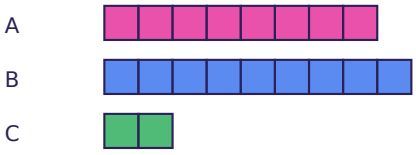

Task card 24 Comparing & Ordering Lengths

How many cubes long is ribbon B?

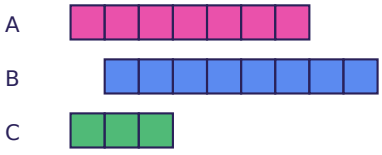

Comparing & Ordering Lengths Task Cards

Recording sheet · Grade 1 · Look at the ribbons (or read the clues) and answer the question.

Name: _____ Date: _____

Scan to check your answers

1	2	3	4
5	6	7	8
9	10	11	12
13	14	15	16
17	18	19	20
21	22	23	24

Comparing & Ordering Lengths Task Cards: Answer Key

Grade 1 · Hard

The answers online

1. 1	**2.** 2	**3.** Leo
4. Zoe	**5.** C	**6.** Lily
7. A	**8.** 2	**9.** B
10. Mia	**11.** 6	**12.** 4
13. 3	**14.** 3	**15.** Nora
16. 1	**17.** 4	**18.** Max
19. 4	**20.** 2	**21.** Ben
22. 1	**23.** 7	**24.** 8