Task card 1 Comparing & Ordering Lengths

Which ribbon is the longest?

Write A, B, or C.



Task card 2 Comparing & Ordering Lengths

Which ribbon is the shortest?

Write A, B, or C.



Task card 3 Comparing & Ordering Lengths

Which ribbon is the longest?

Write A, B, or C.



Task card 4 Comparing & Ordering Lengths

Which ribbon is the longest?

Write A, B, or C.



Task card 5 Comparing & Ordering Lengths

Which ribbon is the shortest?

Write A, B, or C.



Task card 6 Comparing & Ordering Lengths

Which ribbon is the longest?

Write A, B, or C.



Task card 7 Comparing & Ordering Lengths

Which ribbon is the shortest?

Write A, B, or C.



Task card 8 Comparing & Ordering Lengths

Which ribbon is the shortest?

Write A, B, or C.



Task card 9 Comparing & Ordering Lengths

Which ribbon is the shortest?

Write A, B, or C.



Task card 10 Comparing & Ordering Lengths

Which ribbon is the longest?

Write A, B, or C.



Task card 11 Comparing & Ordering Lengths

Which ribbon is the shortest?

Write A, B, or C.



Task card 12 Comparing & Ordering Lengths

Which ribbon is the longest?

Write A, B, or C.



Task card 13 Comparing & Ordering Lengths

Which ribbon is the longest?

Write A, B, or C.



Task card 14 Comparing & Ordering Lengths

Which ribbon is the longest?

Write A, B, or C.

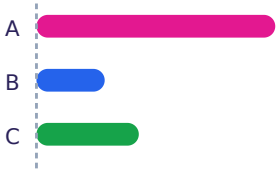

Task card 15 Comparing & Ordering Lengths

Which ribbon is the shortest?

Write A, B, or C.



Task card 16 Comparing & Ordering Lengths

Which ribbon is the shortest?

Write A, B, or C.



Task card 17 Comparing & Ordering Lengths

Which ribbon is the longest?

Write A, B, or C.



Task card 18 Comparing & Ordering Lengths

How many cubes long is ribbon B?

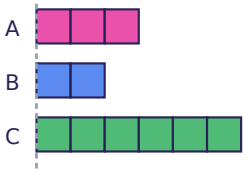

Task card 19 Comparing & Ordering Lengths

How many cubes long is ribbon B?

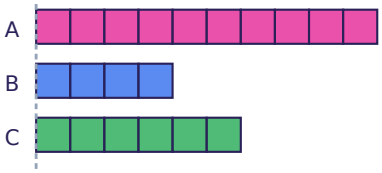

Task card 20 Comparing & Ordering Lengths

How many cubes long is ribbon C?

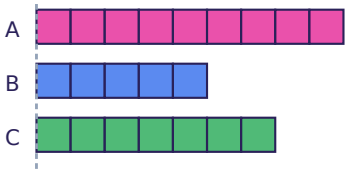

Task card 21 Comparing & Ordering Lengths

Which ribbon is the longest? Write A, B, or C.



Task card 22 Comparing & Ordering Lengths

Which ribbon is the shortest? Write A, B, or C.



Task card 23 Comparing & Ordering Lengths

Which ribbon is the shortest? Write A, B, or C.



Task card 24 Comparing & Ordering Lengths

Which ribbon is the longest? Write A, B, or C.

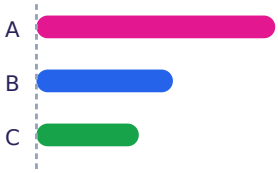

Comparing & Ordering Lengths Task Cards

Recording sheet · Grade 1 · Look at the ribbons (or read the clues) and answer the question.

Name: _____ Date: _____

Scan to check your answers

1	2	3	4
5	6	7	8
9	10	11	12
13	14	15	16
17	18	19	20
21	22	23	24

Comparing & Ordering Lengths Task Cards: Answer Key

Grade 1 · Easy

The answers online

1. B	**2.** A	**3.** A
4. A	**5.** B	**6.** C
7. B	**8.** C	**9.** B
10. C	**11.** C	**12.** C
13. C	**14.** A	**15.** B
16. A	**17.** B	**18.** 2
19. 4	**20.** 7	**21.** C
22. A	**23.** A	**24.** A