Comparing & Ordering Lengths · 1

Which ribbon is the longest? Write A, B, or C.



Comparing & Ordering Lengths · 2

Which ribbon is the shortest? Write A, B, or C.



Comparing & Ordering Lengths · 3

Which ribbon is the longest? Write A, B, or C.



Comparing & Ordering Lengths · 4

Which ribbon is the longest? Write A, B, or C.



Comparing & Ordering Lengths · 5

Which ribbon is the shortest? Write A, B, or C.



Comparing & Ordering Lengths · 6

Which ribbon is the longest? Write A, B, or C.



Comparing & Ordering Lengths · 7

Which ribbon is the shortest? Write A, B, or C.



Comparing & Ordering Lengths · 8

Which ribbon is the shortest? Write A, B, or C.



Comparing & Ordering Lengths · 2

ANSWER

A

Comparing & Ordering Lengths · 1

ANSWER

B

Comparing & Ordering Lengths · 4

ANSWER

A

Comparing & Ordering Lengths · 3

ANSWER

A

Comparing & Ordering Lengths · 6

ANSWER

C

Comparing & Ordering Lengths · 5

ANSWER

B

Comparing & Ordering Lengths · 8

ANSWER

C

Comparing & Ordering Lengths · 7

ANSWER

B

Comparing & Ordering Lengths · 9

Which ribbon is the shortest? Write A, B, or C.



Comparing & Ordering Lengths · 10

Which ribbon is the longest? Write A, B, or C.



Comparing & Ordering Lengths · 11

Which ribbon is the shortest? Write A, B, or C.

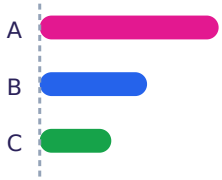

Comparing & Ordering Lengths · 12

Which ribbon is the longest? Write A, B, or C.



Comparing & Ordering Lengths · 13

Which ribbon is the longest? Write A, B, or C.



Comparing & Ordering Lengths · 14

Which ribbon is the longest? Write A, B, or C.

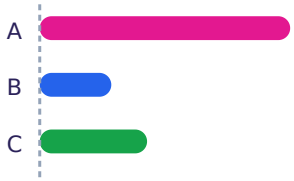

Comparing & Ordering Lengths · 15

Which ribbon is the shortest? Write A, B, or C.



Comparing & Ordering Lengths · 16

Which ribbon is the shortest? Write A, B, or C.



Comparing & Ordering Lengths · 10

ANSWER

C

Comparing & Ordering Lengths · 9

ANSWER

B

Comparing & Ordering Lengths · 12

ANSWER

C

Comparing & Ordering Lengths · 11

ANSWER

C

Comparing & Ordering Lengths · 14

ANSWER

A

Comparing & Ordering Lengths · 13

ANSWER

C

Comparing & Ordering Lengths · 16

ANSWER

A

Comparing & Ordering Lengths · 15

ANSWER

B

Comparing & Ordering Lengths · 17

Which ribbon is the longest? Write A, B, or C.



Comparing & Ordering Lengths · 18

How many cubes long is ribbon B?

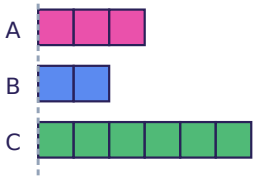

Comparing & Ordering Lengths · 19

How many cubes long is ribbon B?

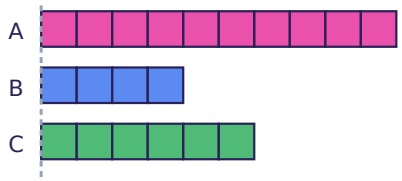

Comparing & Ordering Lengths · 20

How many cubes long is ribbon C?

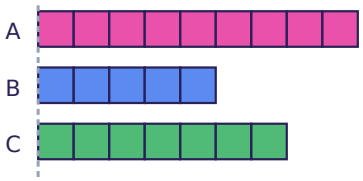

Comparing & Ordering Lengths · 21

Which ribbon is the longest? Write A, B, or C.



Comparing & Ordering Lengths · 22

Which ribbon is the shortest? Write A, B, or C.



Comparing & Ordering Lengths · 23

Which ribbon is the shortest? Write A, B, or C.



Comparing & Ordering Lengths · 24

Which ribbon is the longest? Write A, B, or C.

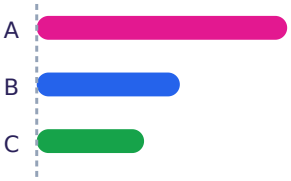

Comparing & Ordering Lengths · 18

ANSWER

2

Comparing & Ordering Lengths · 17

ANSWER

B

Comparing & Ordering Lengths · 20

ANSWER

7

Comparing & Ordering Lengths · 19

ANSWER

4

Comparing & Ordering Lengths · 22

ANSWER

A

Comparing & Ordering Lengths · 21

ANSWER

C

Comparing & Ordering Lengths · 24

ANSWER

A

Comparing & Ordering Lengths · 23

ANSWER

A