**Task card 1** Column Addition within 20

Add.

$$\begin{array}{r} 10 \\ +\ 1 \\ \hline \end{array}$$

**Task card 2** Column Addition within 20

Add.

$$\begin{array}{r} 13 \\ +\ 5 \\ \hline \end{array}$$

**Task card 3** Column Addition within 20

Add.

$$\begin{array}{r} 11 \\ +\ 5 \\ \hline \end{array}$$

**Task card 4** Column Addition within 20

Count them all. 10 + 7 = ___



**Task card 5** Column Addition within 20

10 + 5 = ___

**Task card 6** Column Addition within 20

10 + ___ = 12

**Task card 7** Column Addition within 20

Zoe has 11 toy cars and gets 5 more. How many toy cars does Zoe have now?

**Task card 8** Column Addition within 20

$11 + 4 = 12 + ___$

**Task card 9** Column Addition within 20

Add.

$$\begin{array}{r} 1 \\ +\ 18 \\ \hline \end{array}$$

**Task card 10** Column Addition within 20

Add.

$$\begin{array}{r} 1 \\ +\ 16 \\ \hline \end{array}$$

**Task card 11** Column Addition within 20

Add the tens, then the ones. 14 + 3 = ___

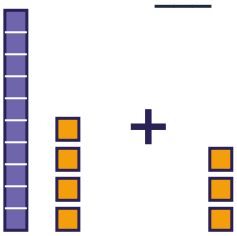

**Task card 12** Column Addition within 20

$15 + 4 = ___$

**Task card 13** Column Addition within 20

$12 + ___ = 15$

**Task card 14** Column Addition within 20

Sam has 11 marbles and gets 4 more. How many marbles does Sam have now?

**Task card 15** Column Addition within 20

$7 + 12 = 9 + ___$

**Task card 16** Column Addition within 20

Add.

$$\begin{array}{r} 12 \\ +\ 8 \\ \hline \end{array}$$

**Task card 17** Column Addition within 20

Add.

$$\begin{array}{r} 6 \\ +\ 9 \\ \hline \end{array}$$

**Task card 18** Column Addition within 20

Add.

$$\begin{array}{r} 4 \\ +\ 9 \\ \hline \end{array}$$

**Task card 19** Column Addition within 20

Add the tens, then the ones. 14 + 6 = ___

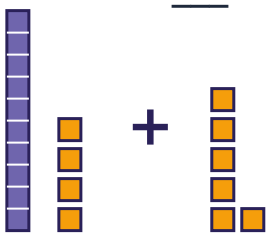

**Task card 20** Column Addition within 20

Make a ten: 9 + 1 = 10, and 6 more. 9 + 7 = ___

**Task card 21** Column Addition within 20

4 + ___ = 12

**Task card 22** Column Addition within 20

Leo has 14 buttons and gets 6 more. How many buttons does Leo have now?

**Task card 23** Column Addition within 20

6 + 7 = 8 + ___

**Task card 24** Column Addition within 20

Add.

$$\begin{array}{r} 16 \\ +\ \ 2 \\ \hline \end{array}$$

# Column Addition within 20 Task Cards

Recording sheet · Grade 1 · Add. Start with the ones. The same kind of sum comes in different shapes.

Name: _____ Date: _____

Scan to check your answers

| | | | |
|---|---|---|---|
| 1 | 2 | 3 | 4 |
| 5 | 6 | 7 | 8 |
| 9 | 10 | 11 | 12 |
| 13 | 14 | 15 | 16 |
| 17 | 18 | 19 | 20 |
| 21 | 22 | 23 | 24 |

# Column Addition within 20 Task Cards: Answer Key

Grade 1 · Medium

The answers online

| | | |
|---|---|---|
| **1.** 11 | **2.** 18 | **3.** 16 |
| **4.** 17 | **5.** 15 | **6.** 2 |
| **7.** 16 | **8.** 3 | **9.** 19 |
| **10.** 17 | **11.** 17 | **12.** 19 |
| **13.** 3 | **14.** 15 | **15.** 10 |
| **16.** 20 | **17.** 15 | **18.** 13 |
| **19.** 20 | **20.** 16 | **21.** 8 |
| **22.** 20 | **23.** 5 | **24.** 18 |