Column Addition within 20 · 1

Add.

$$\begin{array}{r} 10 \\ +\ 1 \\ \hline \end{array}$$

Column Addition within 20 · 2

Add.

$$\begin{array}{r} 13 \\ +\ 5 \\ \hline \end{array}$$

Column Addition within 20 · 3

Add.

$$\begin{array}{r} 11 \\ +\ 5 \\ \hline \end{array}$$

Column Addition within 20 · 4

Count them all. 10 + 7 = ___



Column Addition within 20 · 5

$10 + 5 = ___$

Column Addition within 20 · 6

$10 + ___ = 12$

Column Addition within 20 · 7

Zoe has 11 toy cars and gets 5 more. How many toy cars does Zoe have now?

Column Addition within 20 · 8

$11 + 4 = 12 + ___$

Column Addition within 20 · 2

ANSWER

18

Column Addition within 20 · 1

ANSWER

11

Column Addition within 20 · 4

ANSWER

17

Column Addition within 20 · 3

ANSWER

16

Column Addition within 20 · 6

ANSWER

2

Column Addition within 20 · 5

ANSWER

15

Column Addition within 20 · 8

ANSWER

3

Column Addition within 20 · 7

ANSWER

16

Column Addition within 20 · 9

Add.

$$\begin{array}{r} 1 \\ +\ 18 \\ \hline \end{array}$$

Column Addition within 20 · 10

Add.

$$\begin{array}{r} 1 \\ +\ 16 \\ \hline \end{array}$$

Column Addition within 20 · 11

Add the tens, then the ones.

14 + 3 = ___

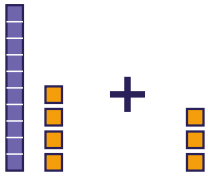

Column Addition within 20 · 12

15 + 4 = ___

Column Addition within 20 · 13

12 + ___ = 15

Column Addition within 20 · 14

Sam has 11 marbles and gets 4 more. How many marbles does Sam have now?

Column Addition within 20 · 15

7 + 12 = 9 + ___

Column Addition within 20 · 16

Add.

$$\begin{array}{r} 12 \\ +\ 8 \\ \hline \end{array}$$

Column Addition within 20 · 10

ANSWER

17

Column Addition within 20 · 9

ANSWER

19

Column Addition within 20 · 12

ANSWER

19

Column Addition within 20 · 11

ANSWER

17

Column Addition within 20 · 14

ANSWER

15

Column Addition within 20 · 13

ANSWER

3

Column Addition within 20 · 16

ANSWER

20

Column Addition within 20 · 15

ANSWER

10

Column Addition within 20 · 17

Add.

$$\begin{array}{r} 6 \\ +\ 9 \\ \hline \end{array}$$

Column Addition within 20 · 18

Add.

$$\begin{array}{r} 4 \\ +\ 9 \\ \hline \end{array}$$

Column Addition within 20 · 19

Add the tens, then the ones.

14 + 6 = ___

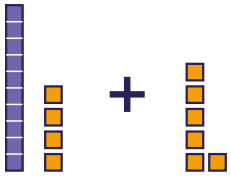

Column Addition within 20 · 20

Make a ten: 9 + 1 = 10, and 6 more. 9 + 7 = ___

Column Addition within 20 · 21

4 + ___ = 12

Column Addition within 20 · 22

Leo has 14 buttons and gets 6 more. How many buttons does Leo have now?

Column Addition within 20 · 23

6 + 7 = 8 + ___

Column Addition within 20 · 24

Add.

$$\begin{array}{r} 16 \\ +\ 2 \\ \hline \end{array}$$

Column Addition within 20 · 18

ANSWER

13

Column Addition within 20 · 17

ANSWER

15

Column Addition within 20 · 20

ANSWER

16

Column Addition within 20 · 19

ANSWER

20

Column Addition within 20 · 22

ANSWER

20

Column Addition within 20 · 21

ANSWER

8

Column Addition within 20 · 24

ANSWER

18

Column Addition within 20 · 23

ANSWER

5