Task card 1 Addition within 20

$5 + 2 = ___$

Task card 2 Addition within 20

$4 + 2 = ___$

Task card 3 Addition within 20

Add.

$$\begin{array}{r} 6 \\ +\ 2 \\ \hline \end{array}$$

Task card 4 Addition within 20

Count them all. 6 + 2 = ___



Task card 5 Addition within 20

The two parts make the whole.

What is the missing number?

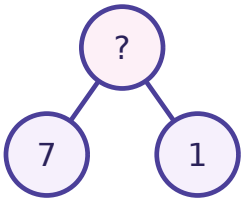

Task card 6 Addition within 20

The two parts make the whole.

What is the missing number?

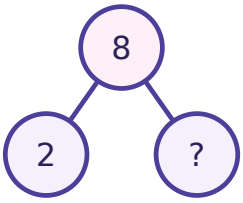

Task card 7 Addition within 20

$4 + ___ = 8$

Task card 8 Addition within 20

$___ + 2 = 8$

Task card 9 Addition within 20

Lily has 3 shells and gets 2 more. How many shells does Lily have now?

Task card 10 Addition within 20

$2 + 6 = 5 + ___$

Task card 11 Addition within 20

$6 + 1 = ___$

Task card 12 Addition within 20

Add.

$$\begin{array}{r} 5 \\ +\ 3 \\ \hline \end{array}$$

Task card 13 Addition within 20

Count them all. 7 + 3 = ___



Task card 14 Addition within 20

The two parts make the whole. What is the missing number?

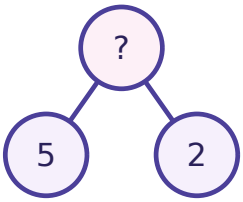

Task card 15 Addition within 20

The two parts make the whole. What is the missing number?

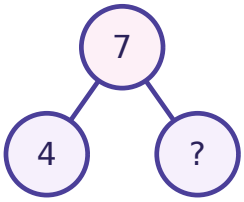

Task card 16 Addition within 20

8 + ___ = 9

Task card 17 Addition within 20

___ + 1 = 10

Task card 18 Addition within 20

Leo has 3 buttons and gets 1 more. How many buttons does Leo have now?

Task card 19 Addition within 20

$8 + 2 = 9 + ___$

Task card 20 Addition within 20

$9 + 3 = ___$

Task card 21 Addition within 20

Add.

$$\begin{array}{r} 1 \\ +\ 10 \\ \hline \end{array}$$

Task card 22 Addition within 20

Count them all. 8 + 3 = ___



Task card 23 Addition within 20

The two parts make the whole.

What is the missing number?

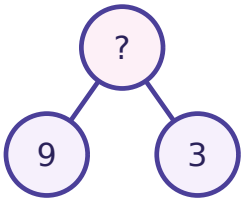

Task card 24 Addition within 20

The two parts make the whole.

What is the missing number?

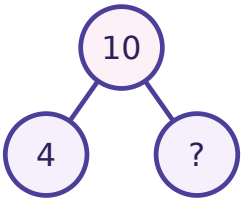

Addition within 20 Task Cards

Recording sheet · Grade 1 · Answer each question. The same facts come in different shapes!

Name: _____ Date: _____

Scan to check your answers

1	2	3	4
5	6	7	8
9	10	11	12
13	14	15	16
17	18	19	20
21	22	23	24

Addition within 20 Task Cards: Answer Key

Grade 1 · Easy

The answers online

1. 7	**2.** 6	**3.** 8
4. 8	**5.** 8	**6.** 6
7. 4	**8.** 6	**9.** 5
10. 3	**11.** 7	**12.** 8
13. 10	**14.** 7	**15.** 3
16. 1	**17.** 9	**18.** 4
19. 1	**20.** 12	**21.** 11
22. 11	**23.** 12	**24.** 6