Addition within 20 · 1

$2 + 5 = ___$

Addition within 20 · 2

$9 + 2 = ___$

Addition within 20 · 3

Add.

$$\begin{array}{r} 11 \\ +\ 1 \\ \hline \end{array}$$

Addition within 20 · 4

Count them all. 5 + 7 = ___



Addition within 20 · 5

The two parts make the whole. What is the missing number?

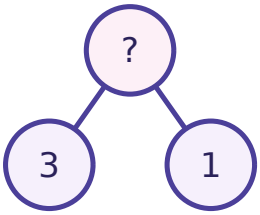

Addition within 20 · 6

The two parts make the whole. What is the missing number?

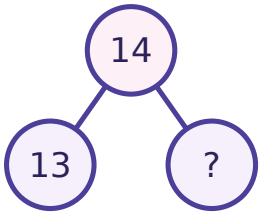

Addition within 20 · 7

$9 + ___ = 12$

Addition within 20 · 8

Make a ten: 6 + 4 = 10, and 2 more. 6 + 6 = ___

Addition within 20 · 2

ANSWER

11

Addition within 20 · 1

ANSWER

7

Addition within 20 · 4

ANSWER

12

Addition within 20 · 3

ANSWER

12

Addition within 20 · 6

ANSWER

1

Addition within 20 · 5

ANSWER

4

Addition within 20 · 8

ANSWER

12

Addition within 20 · 7

ANSWER

3

Addition within 20 · 9

Sam has 12 buttons and gets 1 more. How many buttons does Sam have now?

Addition within 20 · 10

$10 + 4 = 11 + ___$

Addition within 20 · 11

$9 + 1 = ___$

Addition within 20 · 12

$5 + 11 = ___$

Addition within 20 · 13

Add.

$$\begin{array}{r} 1 \\ +\ 9 \\ \hline \end{array}$$

Addition within 20 · 14

Count them all. 2 + 2 = ___



Addition within 20 · 15

The two parts make the whole. What is the missing number?

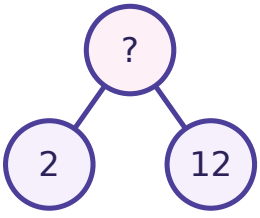

Addition within 20 · 16

The two parts make the whole. What is the missing number?

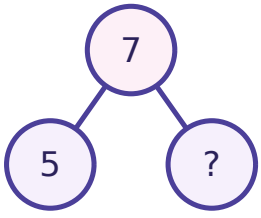

Addition within 20 · 10

ANSWER

3

Addition within 20 · 9

ANSWER

13

Addition within 20 · 12

ANSWER

16

Addition within 20 · 11

ANSWER

10

Addition within 20 · 14

ANSWER

4

Addition within 20 · 13

ANSWER

10

Addition within 20 · 16

ANSWER

2

Addition within 20 · 15

ANSWER

14

Addition within 20 · 17

$9 + ___ = 15$

Addition within 20 · 18

Make a ten: 7 + 3 = 10, and 6 more. 7 + 9 = ___

Addition within 20 · 19

Zoe has 8 marbles and gets 7 more. How many marbles does Zoe have now?

Addition within 20 · 20

$12 + 4 = 13 + ___$

Addition within 20 · 21

$9 + 3 = ___$

Addition within 20 · 22

Add.

$$\begin{array}{r} 4 \\ +\ 10 \\ \hline \end{array}$$

Addition within 20 · 23

Count them all. 8 + 2 = ___



Addition within 20 · 24

The two parts make the whole. What is the missing number?

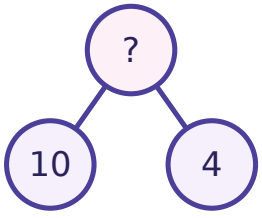

Addition within 20 · 18

ANSWER

16

Addition within 20 · 17

ANSWER

6

Addition within 20 · 20

ANSWER

3

Addition within 20 · 19

ANSWER

15

Addition within 20 · 22

ANSWER

14

Addition within 20 · 21

ANSWER

12

Addition within 20 · 24

ANSWER

14

Addition within 20 · 23

ANSWER

10