Addition within 20 · 1

$16 + 1 = ___$

Addition within 20 · 2

$4 + 10 = ___$

Addition within 20 · 3

Add.

$$\begin{array}{r} 1 \\ +\ 14 \\ \hline \end{array}$$

Addition within 20 · 4

Count them all. $3 + 7 = ___$



Addition within 20 · 5

The two parts make the whole. What is the missing number?

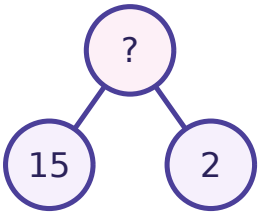

Addition within 20 · 6

The two parts make the whole. What is the missing number?

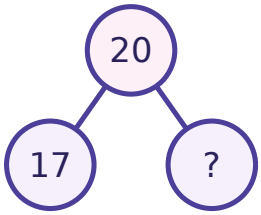

Addition within 20 · 7

$18 + ___ = 20$

Addition within 20 · 8

Make a ten: $8 + 2 = 10$, and 3 more. $8 + 5 = ___$

Addition within 20 · 2

ANSWER

14

Addition within 20 · 1

ANSWER

17

Addition within 20 · 4

ANSWER

10

Addition within 20 · 3

ANSWER

15

Addition within 20 · 6

ANSWER

3

Addition within 20 · 5

ANSWER

17

Addition within 20 · 8

ANSWER

13

Addition within 20 · 7

ANSWER

2

Addition within 20 · 9

Sam has 14 toy cars and gets 2 more. How many toy cars does Sam have now?

Addition within 20 · 10

$13 + 6 = 15 + ___$

Addition within 20 · 11

$12 + 3 = ___$

Addition within 20 · 12

$15 + 3 = ___$

Addition within 20 · 13

Add.

$$\begin{array}{r} 9 \\ +\ 3 \\ \hline \end{array}$$

Addition within 20 · 14

Count them all. $8 + 1 =$ ___



Addition within 20 · 15

The two parts make the whole. What is the missing number?

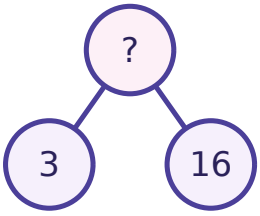

Addition within 20 · 16

The two parts make the whole. What is the missing number?

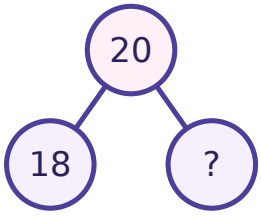

Addition within 20 · 10

ANSWER

4

Addition within 20 · 9

ANSWER

16

Addition within 20 · 12

ANSWER

18

Addition within 20 · 11

ANSWER

15

Addition within 20 · 14

ANSWER

9

Addition within 20 · 13

ANSWER

12

Addition within 20 · 16

ANSWER

2

Addition within 20 · 15

ANSWER

19

Addition within 20 · 17

$15 + ___ = 18$

Addition within 20 · 18

Make a ten: 8 + 2 = 10, and 6 more. 8 + 8 = ___

Addition within 20 · 19

Max has 12 marbles and gets 7 more. How many marbles does Max have now?

Addition within 20 · 20

$5 + 10 = 6 + ___$

Addition within 20 · 21

$6 + 8 = ___$

Addition within 20 · 22

$19 + 1 = ___$

Addition within 20 · 23

Add.

$$\begin{array}{r} 15 \\ +\ \ 2 \\ \hline \end{array}$$

Addition within 20 · 24

Count them all. 6 + 2 = ___



Addition within 20 · 18

ANSWER

16

Addition within 20 · 17

ANSWER

3

Addition within 20 · 20

ANSWER

9

Addition within 20 · 19

ANSWER

19

Addition within 20 · 22

ANSWER

20

Addition within 20 · 21

ANSWER

14

Addition within 20 · 24

ANSWER

8

Addition within 20 · 23

ANSWER

17