Addition within 20 · 1

$5 + 2 = ___$

Addition within 20 · 2

$4 + 2 = ___$

Addition within 20 · 3

Add.

$$\begin{array}{r} 6 \\ +\ 2 \\ \hline \end{array}$$

Addition within 20 · 4

Count them all. $6 + 2 =$ ___



Addition within 20 · 5

The two parts make the whole. What is the missing number?

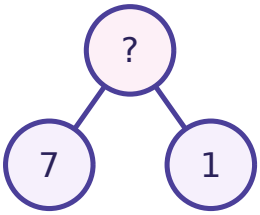

Addition within 20 · 6

The two parts make the whole. What is the missing number?

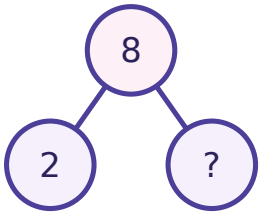

Addition within 20 · 7

$4 + ___ = 8$

Addition within 20 · 8

$___ + 2 = 8$

Addition within 20 · 2

ANSWER

6

Addition within 20 · 1

ANSWER

7

Addition within 20 · 4

ANSWER

8

Addition within 20 · 3

ANSWER

8

Addition within 20 · 6

ANSWER

6

Addition within 20 · 5

ANSWER

8

Addition within 20 · 8

ANSWER

6

Addition within 20 · 7

ANSWER

4

Addition within 20 · 9

Lily has 3 shells and gets 2 more. How many shells does Lily have now?

Addition within 20 · 10

$2 + 6 = 5 + ___$

Addition within 20 · 11

$6 + 1 = ___$

Addition within 20 · 12

Add.

$$\begin{array}{r} 5 \\ +\ 3 \\ \hline \end{array}$$

Addition within 20 · 13

Count them all. $7 + 3 =$ ___



Addition within 20 · 14

The two parts make the whole. What is the missing number?

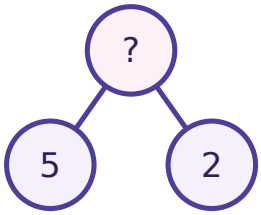

Addition within 20 · 15

The two parts make the whole. What is the missing number?

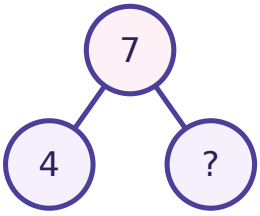

Addition within 20 · 16

$8 + ___ = 9$

Addition within 20 · 10

ANSWER

3

Addition within 20 · 9

ANSWER

5

Addition within 20 · 12

ANSWER

8

Addition within 20 · 11

ANSWER

7

Addition within 20 · 14

ANSWER

7

Addition within 20 · 13

ANSWER

10

Addition within 20 · 16

ANSWER

1

Addition within 20 · 15

ANSWER

3

Addition within 20 · 17

$___ + 1 = 10$

Addition within 20 · 18

Leo has 3 buttons and gets 1 more. How many buttons does Leo have now?

Addition within 20 · 19

$8 + 2 = 9 + ___$

Addition within 20 · 20

$9 + 3 = ___$

Addition within 20 · 21

Add.

$$\begin{array}{r} 1 \\ +\ 10 \\ \hline \end{array}$$

Addition within 20 · 22

Count them all. 8 + 3 = ___



Addition within 20 · 23

The two parts make the whole. What is the missing number?

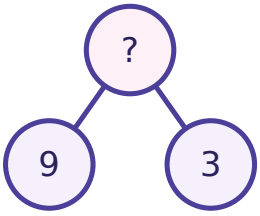

Addition within 20 · 24

The two parts make the whole. What is the missing number?

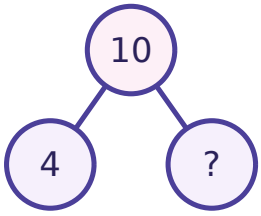

Addition within 20 · 18

ANSWER

4

Addition within 20 · 17

ANSWER

9

Addition within 20 · 20

ANSWER

12

Addition within 20 · 19

ANSWER

1

Addition within 20 · 22

ANSWER

11

Addition within 20 · 21

ANSWER

11

Addition within 20 · 24

ANSWER

6

Addition within 20 · 23

ANSWER

12