Task card 1 Adding Tens

$60 + ___ = 70$

Task card 2 Adding Tens

$___ + 10 = 90$

Task card 3 Adding Tens

$40 + ___ = 50$

Task card 4 Adding Tens

$20 + ___ = 50$

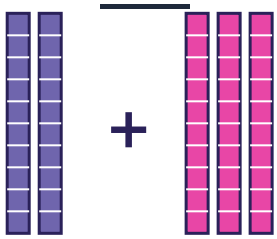

Task card 5 Adding Tens

1 ten + ___ tens

= 6 tens

Task card 6 Adding Tens

Lily has 10 crayons and gets some more. Now Lily has 80. How many more did Lily get?

Task card 7 Adding Tens

$10 + 10 = ___$

Task card 8 Adding Tens

$20 + 70 = 30 + ___$

Task card 9 Adding Tens

$54 + ___ = 64$

Task card 10 Adding Tens

$___ + 20 = 52$

Task card 11 Adding Tens

$13 + 10 = ___$

Task card 12 Adding Tens

$35 + ___ = 55$

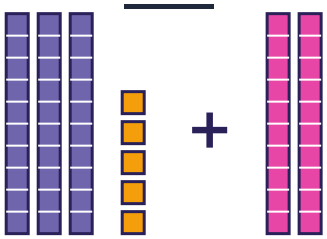

Task card 13 Adding Tens

3 tens + 1 ten = 4 tens. The 4 ones stay. 34 + 10 = ___

Task card 14 Adding Tens

Mia has 49 stickers and gets some more. Now Mia has 59. How many more did Mia get?

Task card 15 Adding Tens

Add.

$$\begin{array}{r} 56 \\ +\ 40 \\ \hline \end{array}$$

Task card 16 Adding Tens

55 + 20 = 65 + ___

Task card 17 Adding Tens

20 + ___ = 30

Task card 18 Adding Tens

___ + 70 = 80

Task card 19 Adding Tens

$10 + ___ = 90$

Task card 20 Adding Tens

$40 + ___ = 70$

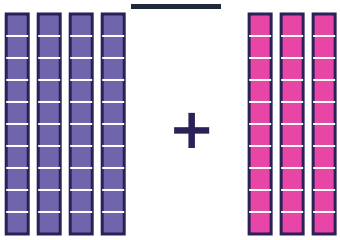

Task card 21 Adding Tens

8 tens + ___ tens = 9 tens

Task card 22 Adding Tens

Leo has 60 marbles and gets some more. Now Leo has 70. How many more did Leo get?

Task card 23 Adding Tens

$60 + 30 = 70 + ___$

Task card 24 Adding Tens

$86 + ___ = 96$

Adding Tens Task Cards

Recording sheet · Grade 1 · Add the tens. The same kind of sum comes in different shapes.

Name: _____ Date: _____

Scan to check your answers

1	2	3	4
5	6	7	8
9	10	11	12
13	14	15	16
17	18	19	20
21	22	23	24

Adding Tens Task Cards: Answer Key

Grade 1 · Hard

The answers online

1. 10	**2.** 80	**3.** 10
4. 30	**5.** 5	**6.** 70
7. 20	**8.** 60	**9.** 10
10. 32	**11.** 23	**12.** 20
13. 44	**14.** 10	**15.** 96
16. 10	**17.** 10	**18.** 10
19. 80	**20.** 30	**21.** 1
22. 10	**23.** 20	**24.** 10