Task card 1 Adding Tens

35 + 20 = ___

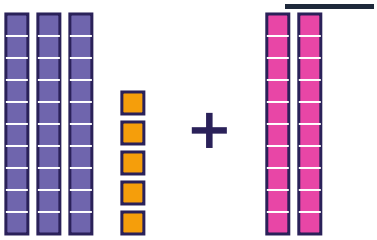

Task card 2 Adding Tens

22 + 70 = ___

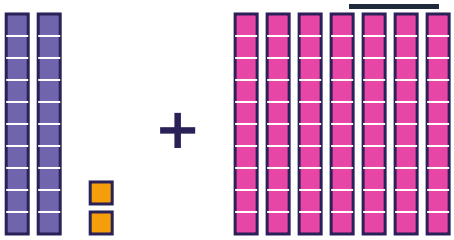

Task card 3 Adding Tens

67 + 20 = ___

Task card 4 Adding Tens

Count the tens and the ones.

How many in all?

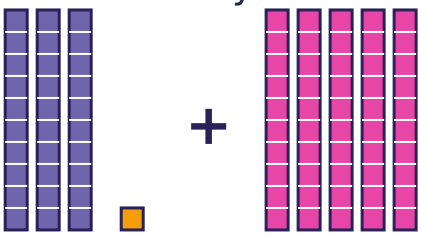

Task card 5 Adding Tens

4 tens + 3 tens = 7 tens. The 7 ones stay. 47 + 30 = ___

Task card 6 Adding Tens

62 + 30: count on 3 tens. 72, 82, ___

Task card 7 Adding Tens

Leo has 17 beads and gets 80 more. How many beads does Leo have now?

Task card 8 Adding Tens

Add.

$$\begin{array}{r} 25 \\ +\ 70 \\ \hline \end{array}$$

Task card 9 Adding Tens

$28 + 40 = ___$

Task card 10 Adding Tens

$46 + 40 = ___$

Task card 11 Adding Tens

$73 + 20 = ___$

Task card 12 Adding Tens

$46 + 40 = ___$

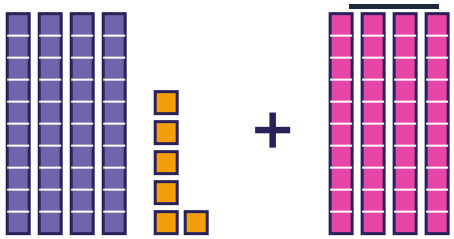

Task card 13 Adding Tens

3 tens + 4 tens = 7 tens. The 8 ones stay. 38 + 40 = ___

Task card 14 Adding Tens

23 + 40: count on 4 tens. 33, 43, 53, ___

Task card 15 Adding Tens

Max has 15 beads and gets 30 more. How many beads does Max have now?

Task card 16 Adding Tens

Add.

$$\begin{array}{r} 48 \\ +\ 30 \\ \hline \end{array}$$

Task card 17 Adding Tens

14 + 70 = ___

Task card 18 Adding Tens

40 + 28 = ___

Task card 19 Adding Tens

82 + 10 = ___

Task card 20 Adding Tens

13 + 10 = ___

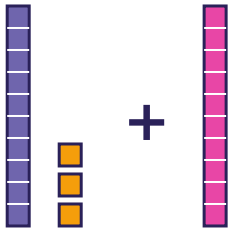

Task card 21 Adding Tens

4 tens + 2 tens = 6 tens. The 2 ones stay. 42 + 20 = ___

Task card 22 Adding Tens

15 + 40: count on 4 tens. 25, 35, 45, ___

Task card 23 Adding Tens

Mia has 41 toy cars and gets 20 more. How many toy cars does Mia have now?

Task card 24 Adding Tens

30 + 68 = ___

Adding Tens Task Cards

Recording sheet · Grade 1 · Add the tens. The same kind of sum comes in different shapes.

Name: _____ Date: _____

Scan to check your answers

1	2	3	4
5	6	7	8
9	10	11	12
13	14	15	16
17	18	19	20
21	22	23	24

Adding Tens Task Cards: Answer Key

Grade 1 · Medium

The answers online

1. 55	**2.** 92	**3.** 87
4. 81	**5.** 77	**6.** 92
7. 97	**8.** 95	**9.** 68
10. 86	**11.** 93	**12.** 86
13. 78	**14.** 63	**15.** 45
16. 78	**17.** 84	**18.** 68
19. 92	**20.** 23	**21.** 62
22. 55	**23.** 61	**24.** 98