Task card 1 Adding Tens

10 + 20 = ___

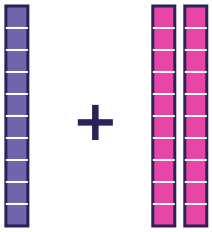

Task card 2 Adding Tens

10 + 10 = ___

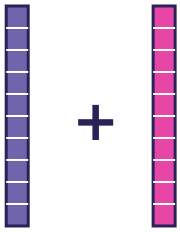

Task card 3 Adding Tens

30 + 20 = ___

Task card 4 Adding Tens

Count the tens. How many in all?

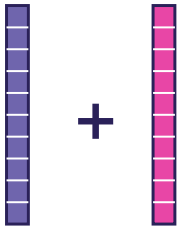

Task card 5 Adding Tens

3 tens + 1 ten = ___ tens

Task card 6 Adding Tens

30 + 20: count on 2 tens. 40, ___

Task card 7 Adding Tens

Lily has 20 stickers and gets 20 more. How many stickers does Lily have now?

Task card 8 Adding Tens

Add.

$$\begin{array}{r} 20 \\ +\ 10 \\ \hline \end{array}$$

Task card 9 Adding Tens

60 + 30 = ___

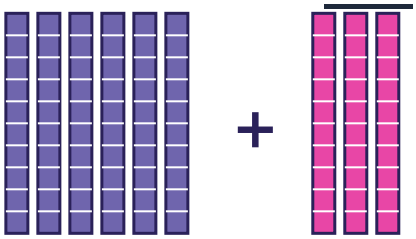

Task card 10 Adding Tens

10 + 50 = ___

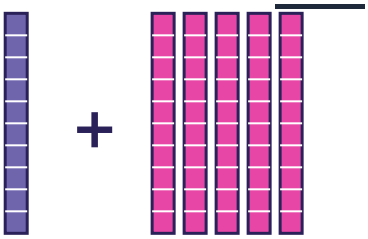

Task card 11 Adding Tens

30 + 50 = ___

Task card 12 Adding Tens

Count the tens. How many in all?

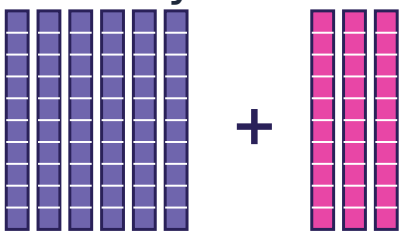

Task card 13 Adding Tens

5 tens + 2 tens = ___ tens

Task card 14 Adding Tens

20 + 20: count on 2 tens. 30, ___

Task card 15 Adding Tens

Max has 70 shells and gets 10 more. How many shells does Max have now?

Task card 16 Adding Tens

60 + 20 = ___

Task card 17 Adding Tens

2 tens + 7 tens = ___ tens

Task card 18 Adding Tens

60 + 10 = ___

Task card 19 Adding Tens

40 + 10 = ___

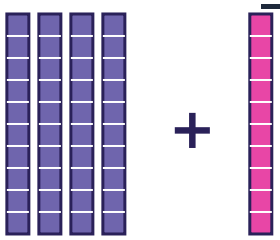

Task card 20 Adding Tens

50 + 40: count on 4 tens. 60, 70, 80, ___

Task card 21 Adding Tens

Add.

$$\begin{array}{r} 70 \\ +\ 10 \\ \hline \end{array}$$

Task card 22 Adding Tens

Zoe has 50 marbles and gets 30 more. How many marbles does Zoe have now?

Task card 23 Adding Tens

1 ten + 1 ten = 2 tens. What number is 2 tens?

Task card 24 Adding Tens

20 + 20 = ___

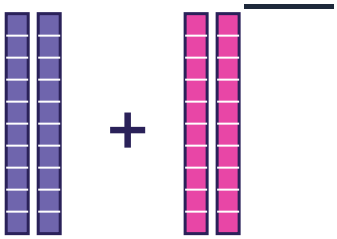

Adding Tens Task Cards

Recording sheet · Grade 1 · Add the tens. The same kind of sum comes in different shapes.

Name: _____ Date: _____

Scan to check your answers

1	2	3	4
5	6	7	8
9	10	11	12
13	14	15	16
17	18	19	20
21	22	23	24

Adding Tens Task Cards: Answer Key

Grade 1 · Easy

The answers online

1. 30	**2.** 20	**3.** 50
4. 20	**5.** 4	**6.** 50
7. 40	**8.** 30	**9.** 90
10. 60	**11.** 80	**12.** 90
13. 7	**14.** 40	**15.** 80
16. 80	**17.** 9	**18.** 70
19. 50	**20.** 90	**21.** 80
22. 80	**23.** 20	**24.** 40