Adding Tens · 1

$60 + ___ = 70$

Adding Tens · 2

$___ + 10 = 90$

Adding Tens · 3

$40 + ___ = 50$

Adding Tens · 4

$20 + ___ = 50$

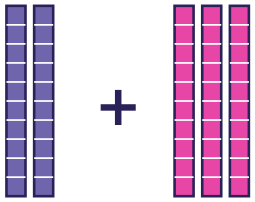

Adding Tens · 5

1 ten + ___ tens = 6 tens

Adding Tens · 6

Lily has 10 crayons and gets some more. Now Lily has 80. How many more did Lily get?

Adding Tens · 7

$10 + 10 = ___$

Adding Tens · 8

$20 + 70 = 30 + ___$

Adding Tens · 2

**ANSWER**

# 80

Adding Tens · 1

**ANSWER**

# 10

Adding Tens · 4

**ANSWER**

# 30

Adding Tens · 3

**ANSWER**

# 10

Adding Tens · 6

**ANSWER**

# 70

Adding Tens · 5

**ANSWER**

# 5

Adding Tens · 8

**ANSWER**

# 60

Adding Tens · 7

**ANSWER**

# 20

Adding Tens · 9

$54 + ___ = 64$

Adding Tens · 10

$___ + 20 = 52$

Adding Tens · 11

$13 + 10 = ___$

Adding Tens · 12

$35 + ___ = 55$

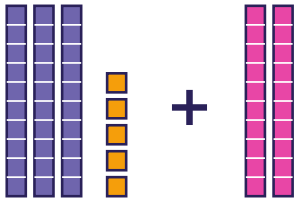

Adding Tens · 13

3 tens + 1 ten = 4 tens. The 4 ones stay. 34 + 10 = ___

Adding Tens · 14

Mia has 49 stickers and gets some more. Now Mia has 59. How many more did Mia get?

Adding Tens · 15

Add.

$$\begin{array}{r} 56 \\ +\ 40 \\ \hline \end{array}$$

Adding Tens · 16

$55 + 20 = 65 +$ ___

Adding Tens · 10

**ANSWER**

# 32

Adding Tens · 9

**ANSWER**

# 10

Adding Tens · 12

**ANSWER**

# 20

Adding Tens · 11

**ANSWER**

# 23

Adding Tens · 14

**ANSWER**

# 10

Adding Tens · 13

**ANSWER**

# 44

Adding Tens · 16

**ANSWER**

# 10

Adding Tens · 15

**ANSWER**

# 96

Adding Tens · 17

$20 + ___ = 30$

Adding Tens · 18

$___ + 70 = 80$

Adding Tens · 19

$10 + ___ = 90$

Adding Tens · 20

$40 + ___ = 70$

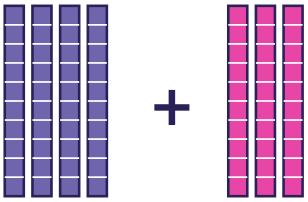

Adding Tens · 21

8 tens + ___ tens

= 9 tens

Adding Tens · 22

Leo has 60 marbles and gets some more. Now Leo has 70. How many more did Leo get?

Adding Tens · 23

$60 + 30 = 70 +$ ___

Adding Tens · 24

$86 + ___ = 96$

Adding Tens · 18

**ANSWER**

# 10

Adding Tens · 17

**ANSWER**

# 10

Adding Tens · 20

**ANSWER**

# 30

Adding Tens · 19

**ANSWER**

# 80

Adding Tens · 22

**ANSWER**

# 10

Adding Tens · 21

**ANSWER**

# 1

Adding Tens · 24

**ANSWER**

# 10

Adding Tens · 23

**ANSWER**

# 20