Adding Tens · 1

35 + 20 = ___

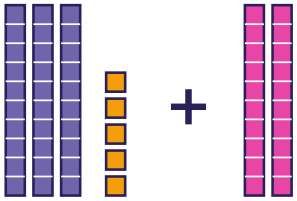

Adding Tens · 2

22 + 70 = ___

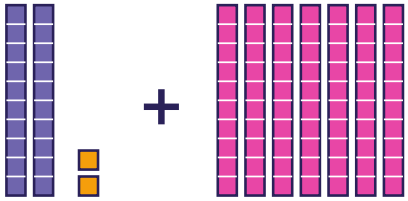

Adding Tens · 3

67 + 20 = ___

Adding Tens · 4

Count the tens and the ones.

How many in all?

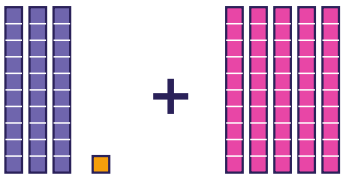

Adding Tens · 5

4 tens + 3 tens = 7 tens. The 7 ones stay. 47 + 30 = ___

Adding Tens · 6

62 + 30: count on 3 tens. 72, 82, ___

Adding Tens · 7

Leo has 17 beads and gets 80 more. How many beads does Leo have now?

Adding Tens · 8

Add.

$$\begin{array}{r} 25 \\ +\ 70 \\ \hline \end{array}$$

Adding Tens · 2

ANSWER

92

Adding Tens · 1

ANSWER

55

Adding Tens · 4

ANSWER

81

Adding Tens · 3

ANSWER

87

Adding Tens · 6

ANSWER

92

Adding Tens · 5

ANSWER

77

Adding Tens · 8

ANSWER

95

Adding Tens · 7

ANSWER

97

Adding Tens · 9

28 + 40 = ___

Adding Tens · 10

46 + 40 = ___

Adding Tens · 11

73 + 20 = ___

Adding Tens · 12

46 + 40 = ___

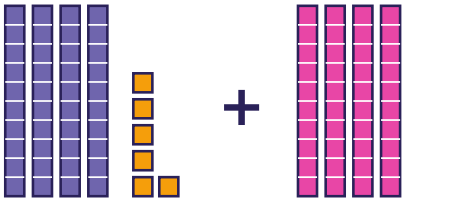

Adding Tens · 13

3 tens + 4 tens = 7 tens. The 8 ones stay. 38 + 40 = ___

Adding Tens · 14

23 + 40: count on 4 tens. 33, 43, 53, ___

Adding Tens · 15

Max has 15 beads and gets 30 more. How many beads does Max have now?

Adding Tens · 16

Add.

$$\begin{array}{r} 48 \\ +\ 30 \\ \hline \end{array}$$

Adding Tens · 10

ANSWER

86

Adding Tens · 9

ANSWER

68

Adding Tens · 12

ANSWER

86

Adding Tens · 11

ANSWER

93

Adding Tens · 14

ANSWER

63

Adding Tens · 13

ANSWER

78

Adding Tens · 16

ANSWER

78

Adding Tens · 15

ANSWER

45

Adding Tens · 17

14 + 70 = ___

Adding Tens · 18

40 + 28 = ___

Adding Tens · 19

82 + 10 = ___

Adding Tens · 20

13 + 10 = ___

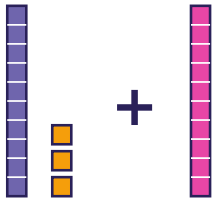

Adding Tens · 21

4 tens + 2 tens = 6 tens. The 2 ones stay. 42 + 20 = ___

Adding Tens · 22

15 + 40: count on 4 tens. 25, 35, 45, ___

Adding Tens · 23

Mia has 41 toy cars and gets 20 more. How many toy cars does Mia have now?

Adding Tens · 24

30 + 68 = ___

Adding Tens · 18

ANSWER

68

Adding Tens · 17

ANSWER

84

Adding Tens · 20

ANSWER

23

Adding Tens · 19

ANSWER

92

Adding Tens · 22

ANSWER

55

Adding Tens · 21

ANSWER

62

Adding Tens · 24

ANSWER

98

Adding Tens · 23

ANSWER

61